Build a picture graph · Workbook

Sort the pictures by kind. Start at the first box in each row. Use the graph in part 2 to answer the questions.

Name: _____ Date: _____

Vehicle depot

1 **Draw one matching picture in each box you use.**

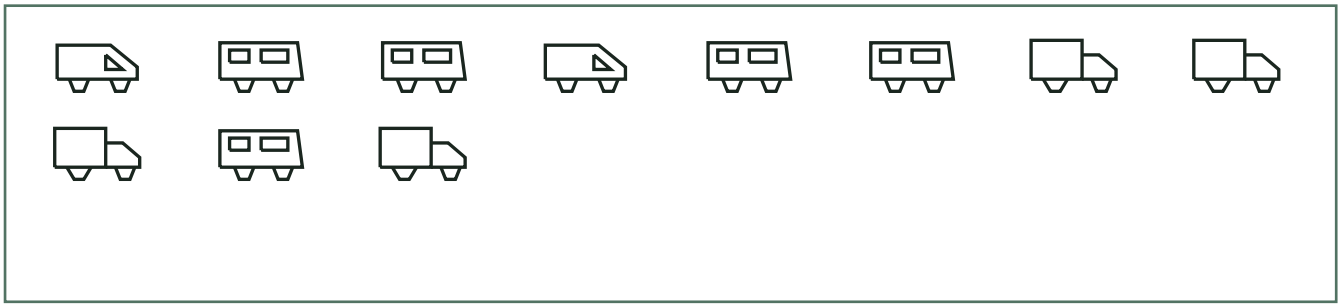

A					
B					
C					

2 **Read this picture graph.**

A					
B					
C					

a) Which group has the most? **B**

b) How many in group C? **2**

Build a picture graph · Workbook

Sort the pictures by kind. Start at the first box in each row. Use the graph in part 2 to answer the questions.

Name: _____ Date: _____

Garden shed

1 **Draw one matching picture in each box you use.**

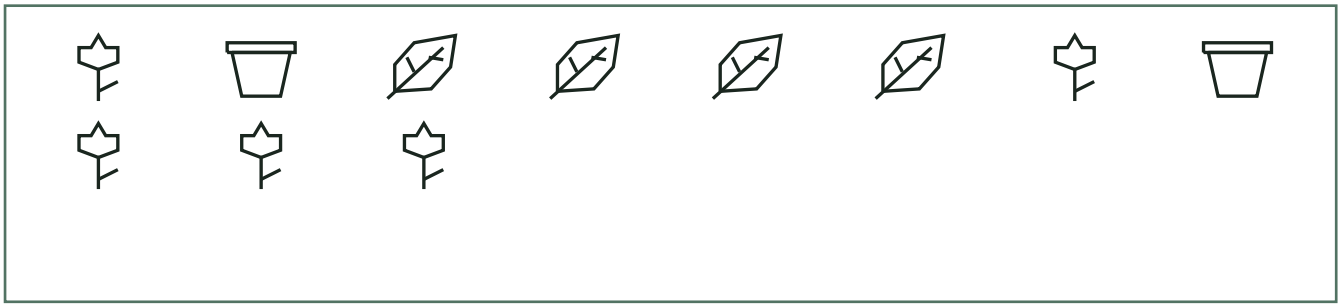

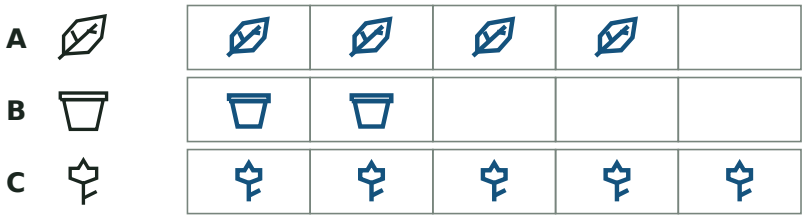

2 **Read this picture graph.**

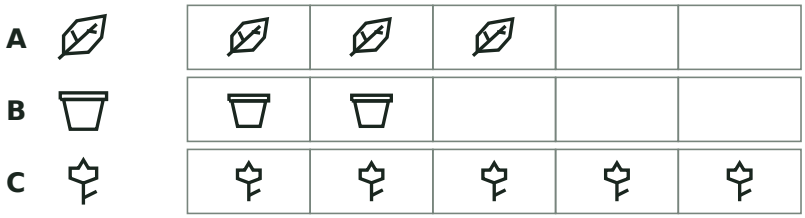

a) Which group has the most? **C**

b) How many in group A? **3**

Build a picture graph · Workbook

Sort the pictures by kind. Start at the first box in each row. Use the graph in part 2 to answer the questions.

Name: _____ Date: _____

Tool bench

1 **Draw one matching picture in each box you use.**

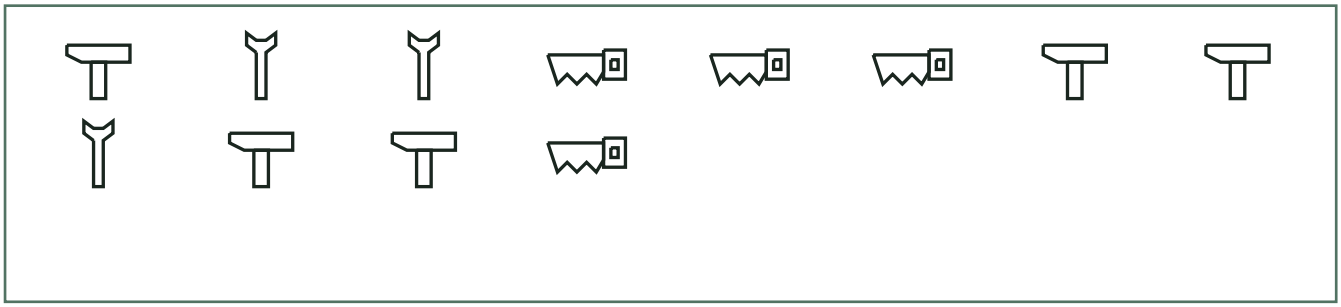

A					
B					
C					

2 **Read this picture graph.**

A					
B					
C					

a) Which group has the most? **C**

b) How many in group A? **4**

Build a picture graph · Workbook

Sort the pictures by kind. Start at the first box in each row. Use the graph in part 2 to answer the questions.

Name: _____ Date: _____

Picnic basket

1 **Draw one matching picture in each box you use.**

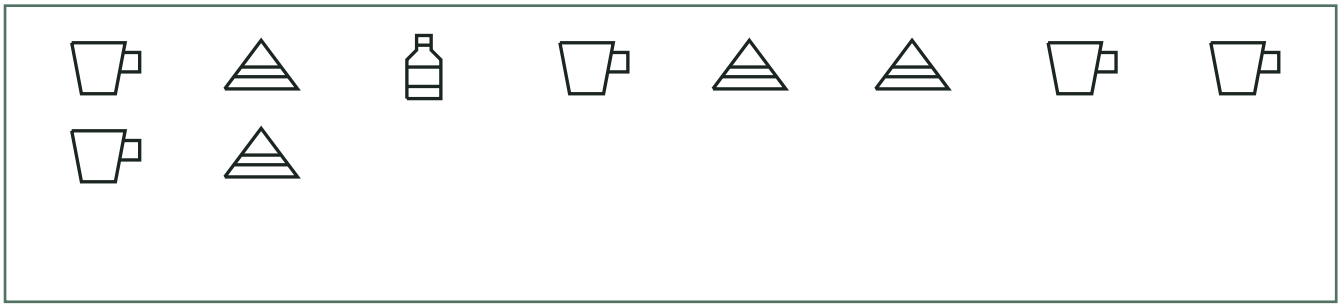

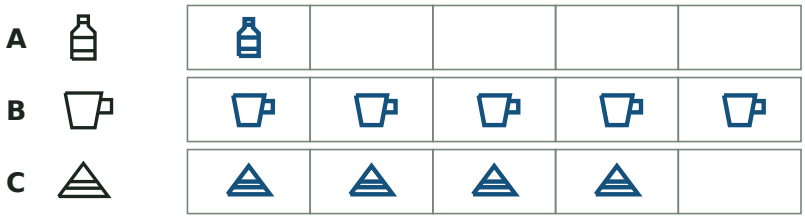

2 **Read this picture graph.**

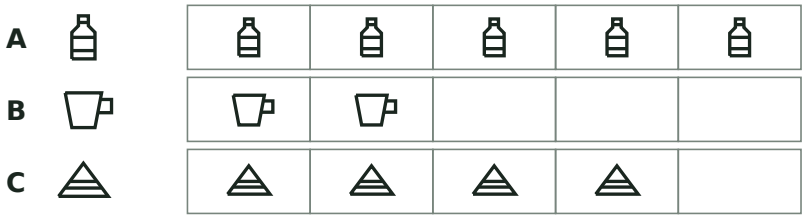

a) Which group has the most? **A**

b) How many in group C? **4**

Build a picture graph · Workbook

Sort the pictures by kind. Start at the first box in each row. Use the graph in part 2 to answer the questions.

Name: _____ Date: _____

In the sky

1 **Draw one matching picture in each box you use.**





2 **Read this picture graph.**



a) Which group has the most? **A**

b) How many in group C? **2**