Build a picture graph · Workbook

Sort the pictures by kind. Start at the first box in each row. Use the graph in part 2 to answer the questions.

Name: _____ Date: _____

Vehicle depot

1 **Draw one matching picture in each box you use.**

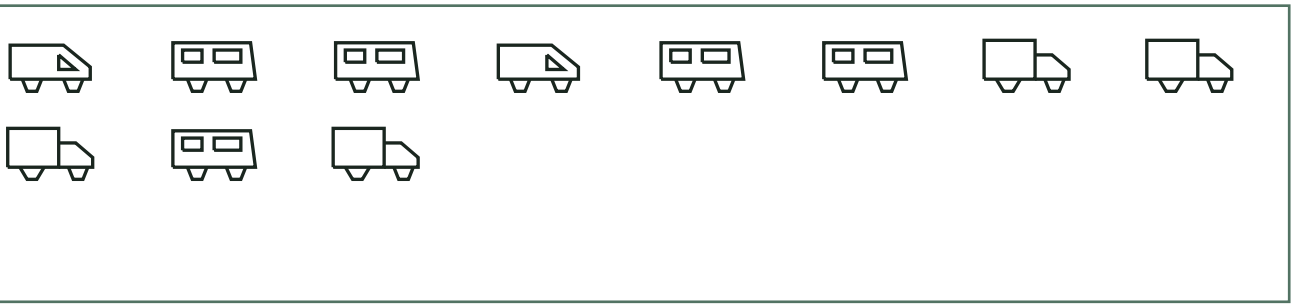

A					
B					
C					

2 **Read this picture graph.**

A					
B					
C					

a) Which group has the most? _____

b) How many in group C? _____

Build a picture graph · Workbook

Sort the pictures by kind. Start at the first box in each row. Use the graph in part 2 to answer the questions.

Name: _____ Date: _____

Garden shed

1 **Draw one matching picture in each box you use.**

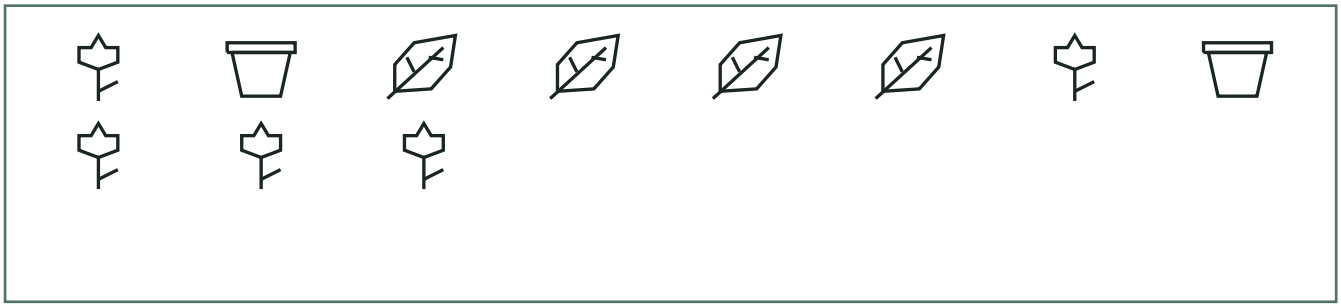

A					
B					
C					

2 **Read this picture graph.**

A					
B					
C					

a) Which group has the most?

b) How many in group A?

Build a picture graph · Workbook

Sort the pictures by kind. Start at the first box in each row. Use the graph in part 2 to answer the questions.

Name: _____ Date: _____

Tool bench

1 **Draw one matching picture in each box you use.**

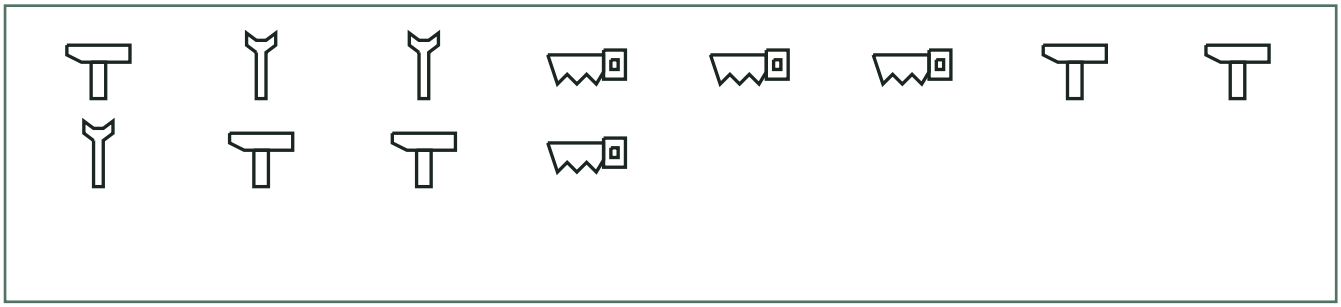

A					
B					
C					

2 **Read this picture graph.**

A					
B					
C					

a) Which group has the most? _____

b) How many in group A? _____

Build a picture graph · Workbook

Sort the pictures by kind. Start at the first box in each row. Use the graph in part 2 to answer the questions.

Name: _____ Date: _____

Picnic basket

1 **Draw one matching picture in each box you use.**

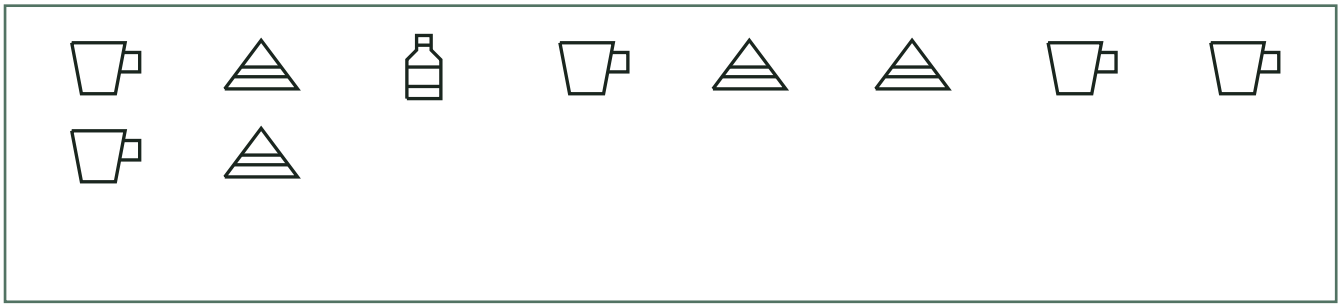

A					
B					
C					

2 **Read this picture graph.**

A					
B					
C					

a) Which group has the most?

b) How many in group C?

Build a picture graph · Workbook

Sort the pictures by kind. Start at the first box in each row. Use the graph in part 2 to answer the questions.

Name: _____ Date: _____

In the sky

1 **Draw one matching picture in each box you use.**



A ☆					
B ◈					
C 🚀					

2 **Read this picture graph.**

A ☆	☆	☆	☆	☆	
B ◈	◈				
C 🚀	🚀	🚀			

a) Which group has the most? ____

b) How many in group C? ____