Labelled bar graphs · Workbook

The letters below the bars match the groups in the table. Use the graph on the right to answer the questions.

Name: _____ Date: _____

Vehicle depot

1 **Use the table to draw the bars.**

A Truck	B Bus	C Van	D Train
6	4	1	3

2 **Read this bar graph.**

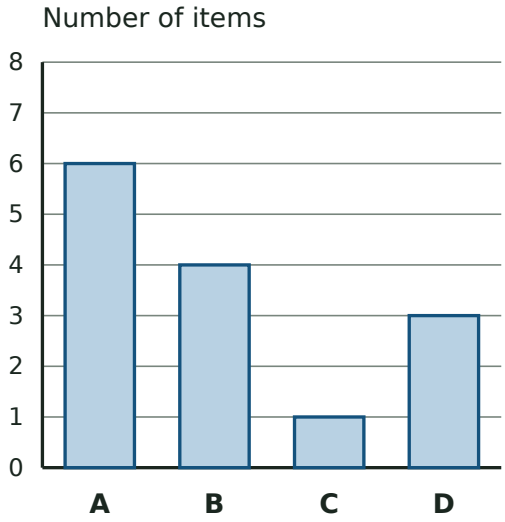

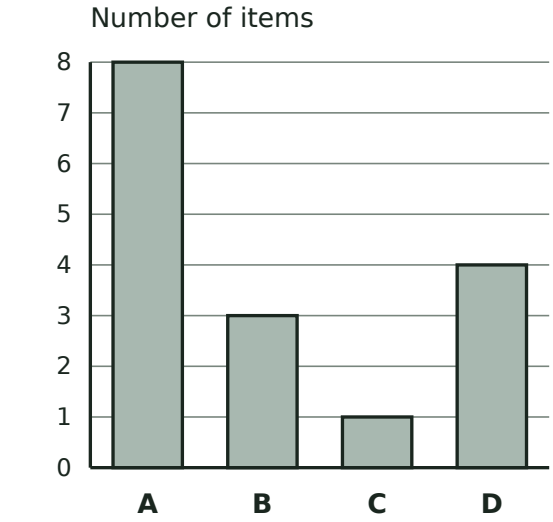

a) Which group has the most? **A**

b) How many in groups A and D altogether? **12**

c) How many more in group A than in group D? **4**

Labelled bar graphs · Workbook

The letters below the bars match the groups in the table. Use the graph on the right to answer the questions.

Name: _____ Date: _____

Garden shed

1 **Use the table to draw the bars.**

A Leaf	B Flower	C Shovel	D Pot
1	8	6	3

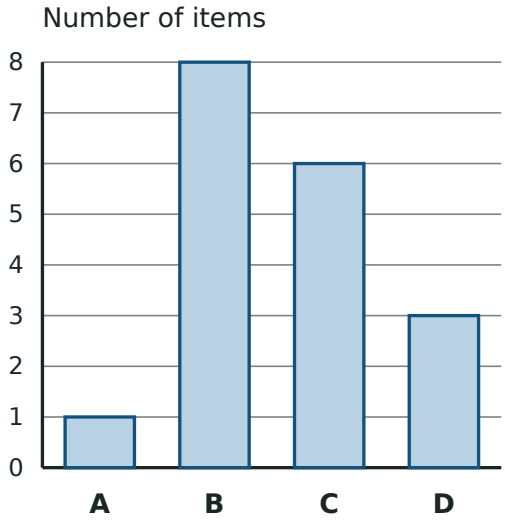

2 **Read this bar graph.**



a) Which group has the most? **B**

b) How many in groups B and A altogether? **13**

c) How many more in group B than in group A? **1**

Labelled bar graphs · Workbook

The letters below the bars match the groups in the table. Use the graph on the right to answer the questions.

Name: _____ Date: _____

Tool bench

1 **Use the table to draw the bars.**

A Saw	B Wrench	C Brush	D Hammer
6	1	8	4

2 **Read this bar graph.**

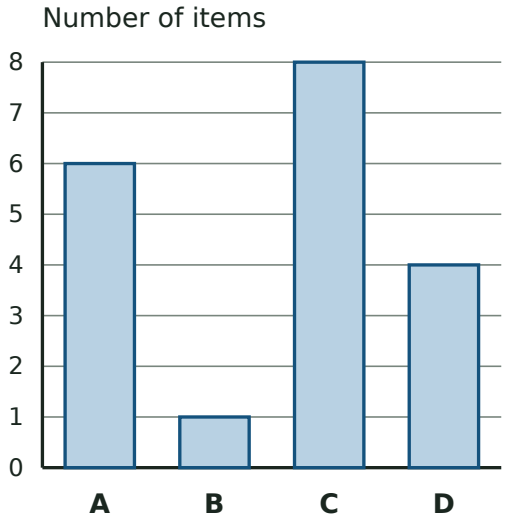

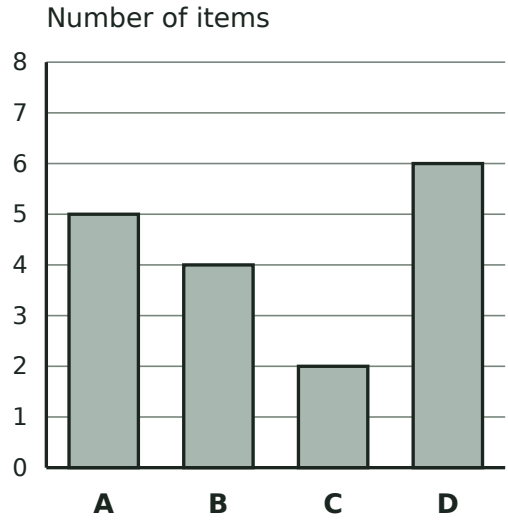

a) Which group has the most? **D**

b) How many in groups D and A altogether? **11**

c) How many more in group D than in group A? **1**

Labelled bar graphs · Workbook

The letters below the bars match the groups in the table. Use the graph on the right to answer the questions.

Name: _____ Date: _____

Picnic basket

1 **Use the table to draw the bars.**

A Sandwich	B Bottle	C Napkin	D Cup
5	4	7	1

2 **Read this bar graph.**

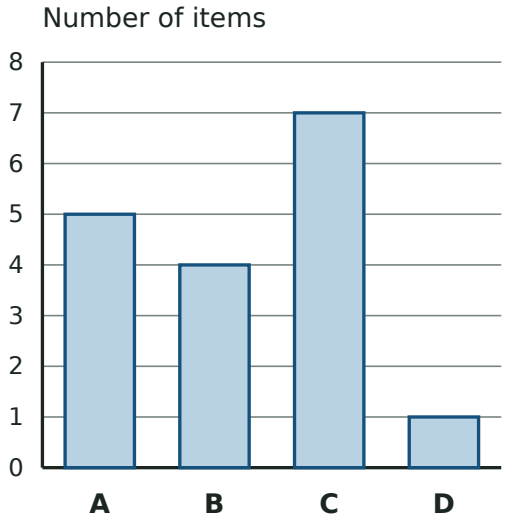

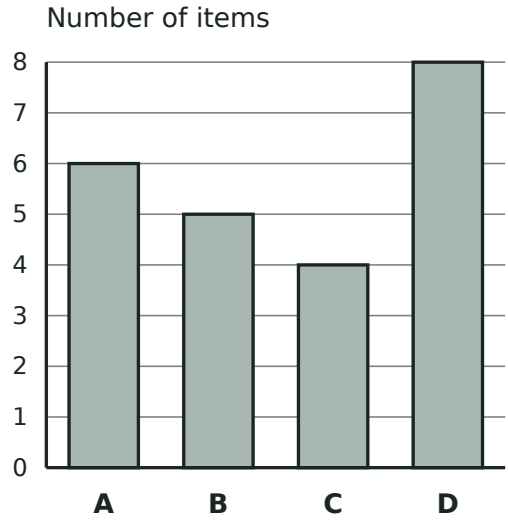

a) Which group has the most? **D**

b) How many in groups D and A altogether? **14**

c) How many more in group D than in group A? **2**

Labelled bar graphs · Workbook

The letters below the bars match the groups in the table. Use the graph on the right to answer the questions.

Name: _____ Date: _____

In the sky

1 **Use the table to draw the bars.**

A Rocket	B Plane	C Kite	D Star
4	7	1	6

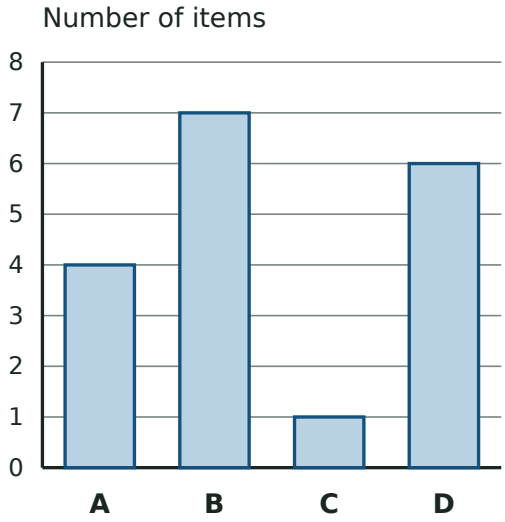

2 **Read this bar graph.**

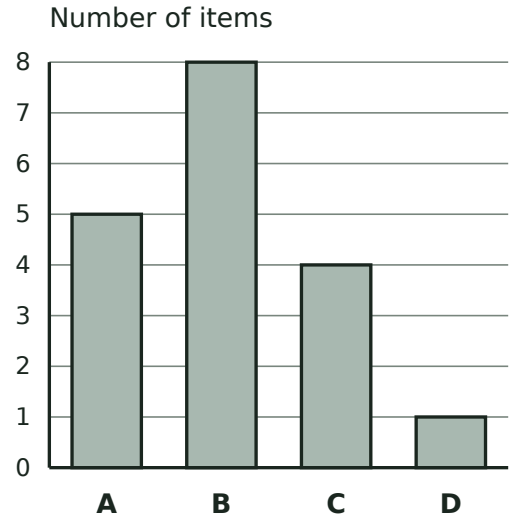

a) Which group has the most? **B**

b) How many in groups B and A altogether? **13**

c) How many more in group B than in group A? **3**