Labelled bar graphs · Workbook

The letters below the bars match the groups in the table. Use the graph on the right to answer the questions.

Name: _____ Date: _____

Vehicle depot

1 **Use the table to draw the bars.**

A Truck	B Bus	C Van	D Train
6	4	1	3

Number of items



2 **Read this bar graph.**

Number of items

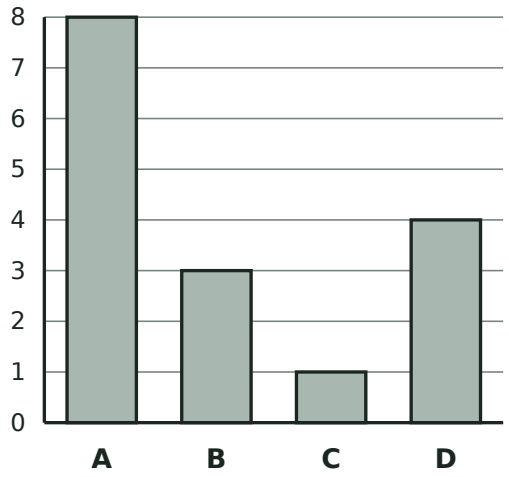

a) Which group has the most? ☐

b) How many in groups A and D altogether? ☐

c) How many more in group A than in group D? ☐

Labelled bar graphs · Workbook

The letters below the bars match the groups in the table. Use the graph on the right to answer the questions.

Name: _____ Date: _____

Garden shed

1 **Use the table to draw the bars.**

A Leaf	B Flower	C Shovel	D Pot
1	8	6	3



2 **Read this bar graph.**

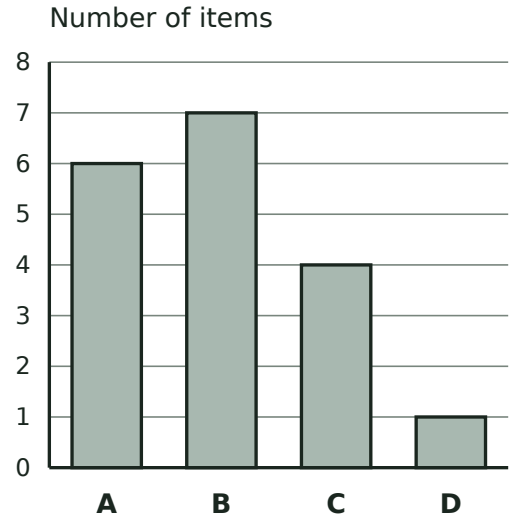

a) Which group has the most?

b) How many in groups B and A altogether?

c) How many more in group B than in group A?

Labelled bar graphs · Workbook

The letters below the bars match the groups in the table. Use the graph on the right to answer the questions.

Name: _____ Date: _____

Tool bench

1 **Use the table to draw the bars.**

A Saw	B Wrench	C Brush	D Hammer
6	1	8	4



2 **Read this bar graph.**

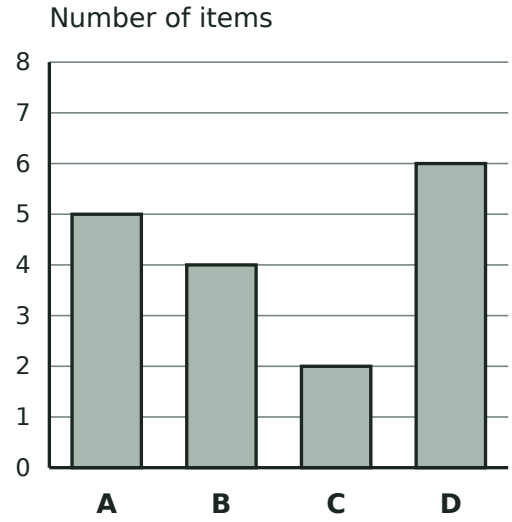

a) Which group has the most?

b) How many in groups D and A altogether?

c) How many more in group D than in group A?

Labelled bar graphs · Workbook

The letters below the bars match the groups in the table. Use the graph on the right to answer the questions.

Name: _____ Date: _____

Picnic basket

1 **Use the table to draw the bars.**

A Sandwich	B Bottle	C Napkin	D Cup
5	4	7	1



2 **Read this bar graph.**

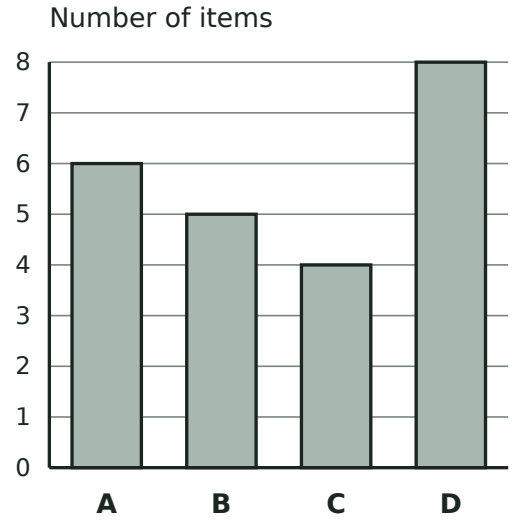

a) Which group has the most? ☐

b) How many in groups D and A altogether? ☐

c) How many more in group D than in group A? ☐

Labelled bar graphs · Workbook

The letters below the bars match the groups in the table. Use the graph on the right to answer the questions.

Name: _____ Date: _____

In the sky

1 **Use the table to draw the bars.**

A Rocket	B Plane	C Kite	D Star
4	7	1	6



2 **Read this bar graph.**

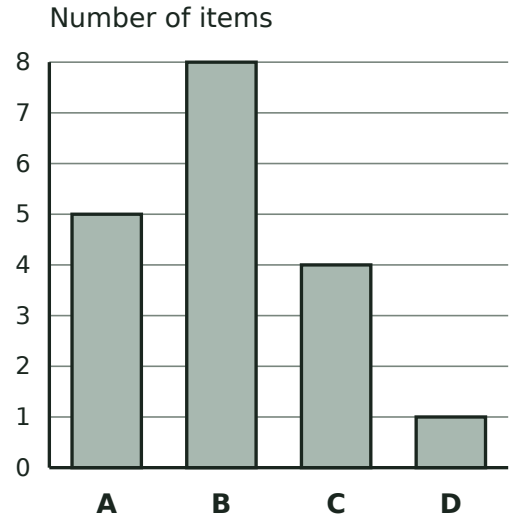

a) Which group has the most? ☐

b) How many in groups B and A altogether? ☐

c) How many more in group B than in group A? ☐