Tallies and bars · Workbook

Sort the pictures by kind. Start each bar in its first box. Then answer questions about the bars in part 2.

Name: _____ Date: _____

Vehicle depot

1 **Make tallies, then shade one square per item.**

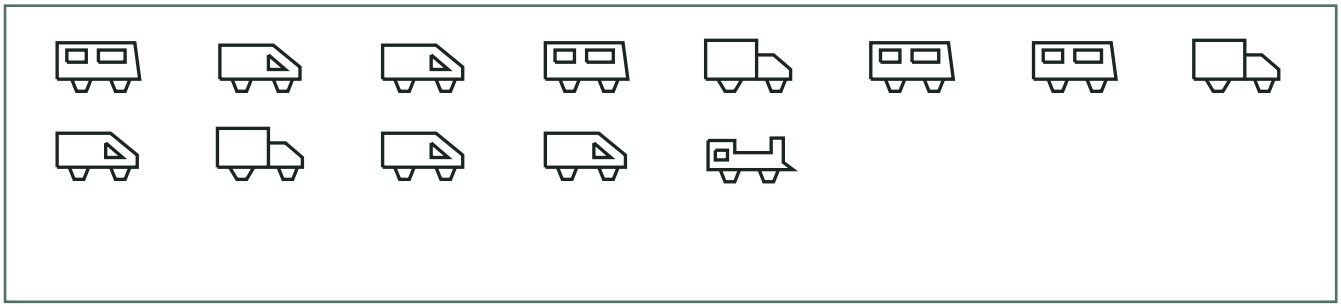

	Tallies	Bars
A		
B		
C		
D		

2 **Read these bars.**



a) Which group has the most?

b) How many in group D?

Tallies and bars · Workbook

Sort the pictures by kind. Start each bar in its first box. Then answer questions about the bars in part 2.

Name: _____ Date: _____

Garden shed

1 **Make tallies, then shade one square per item.**

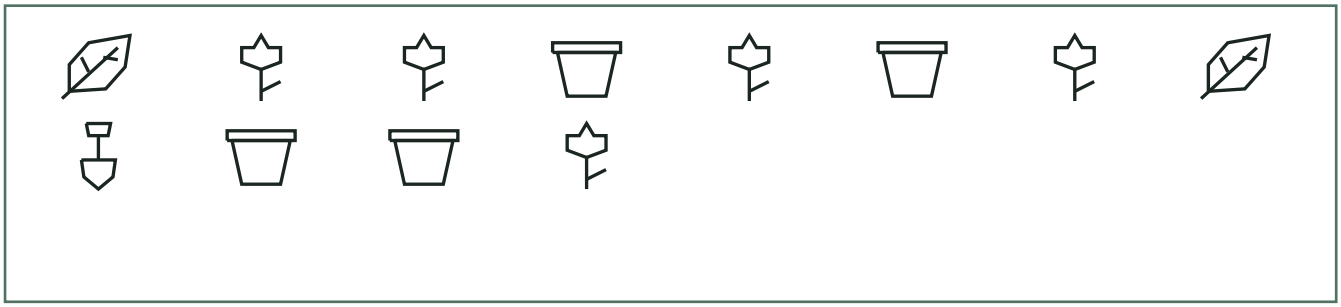

	Tallies	Bars
A		
B		
C		
D		

2 **Read these bars.**

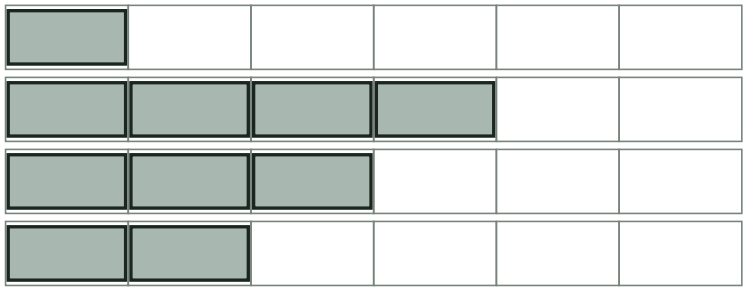

a) Which group has the most?

b) How many in group C?

Tallies and bars · Workbook

Sort the pictures by kind. Start each bar in its first box. Then answer questions about the bars in part 2.

Name: _____ Date: _____

Tool bench

1 **Make tallies, then shade one square per item.**

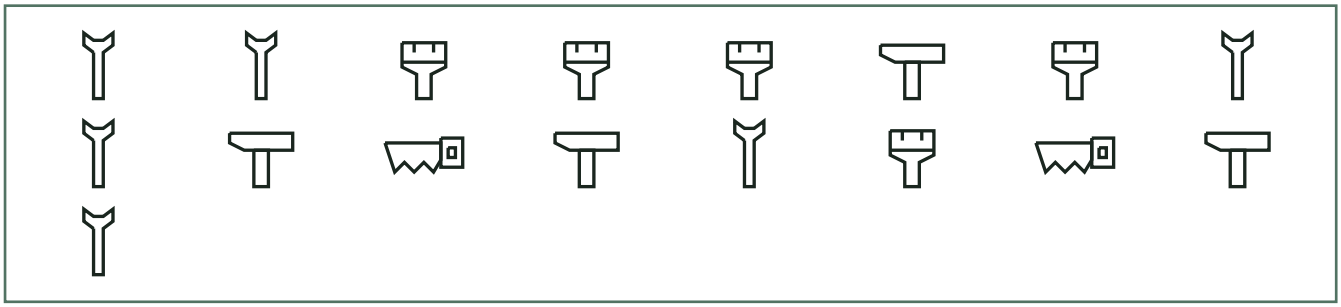

	Tallies	Bars					
A							
B							
C							
D							

2 **Read these bars.**



a) Which group has the most? ____

b) How many in group A? ____

Tallies and bars · Workbook

Sort the pictures by kind. Start each bar in its first box. Then answer questions about the bars in part 2.

Name: _____ Date: _____

Picnic basket

1 **Make tallies, then shade one square per item.**

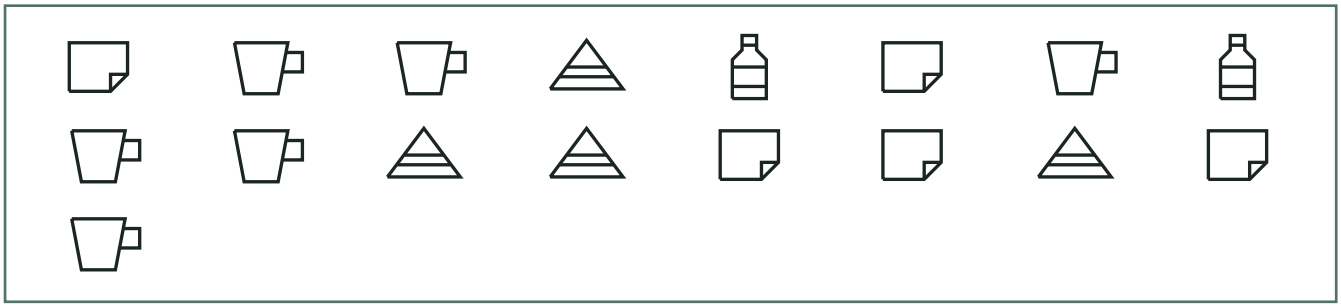

	Tallies	Bars
A		
B		
C		
D		

2 **Read these bars.**



a) Which group has the most?

b) How many in group A?

Tallies and bars · Workbook

Sort the pictures by kind. Start each bar in its first box. Then answer questions about the bars in part 2.

Name: _____ Date: _____

In the sky

1 **Make tallies, then shade one square per item.**

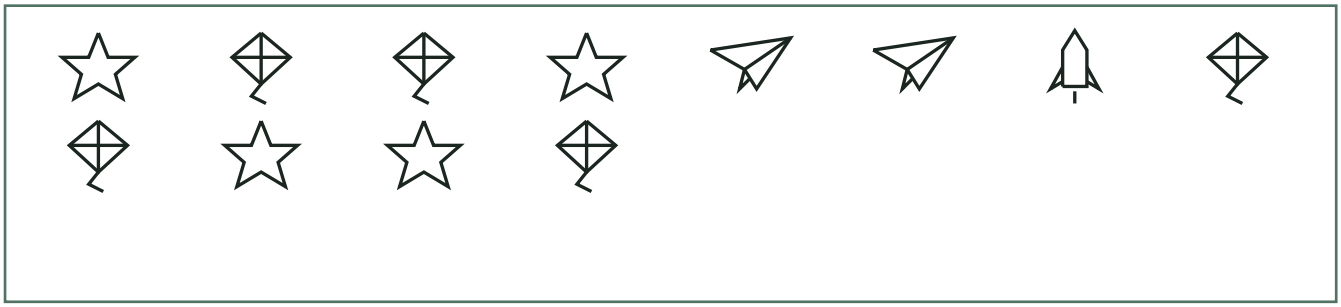

	Tallies	Bars
A		
B		
C		
D		

2 **Read these bars.**



a) Which group has the most?

b) How many in group A?