Classify rectangles and squares · Workbook

Use the directions and shapes on each page. An adult can read the directions aloud.

Name: _____ Date: _____

Tile Inspector

Circle the tile that fits the whole clue.

A rectangle is a quadrilateral with four right angles.
A square is a rectangle with four equal sides.
A quadrilateral is a polygon with four straight sides.

1 Rectangle with 4 equal sides



A B C

2 Rectangle with 2 side lengths



A B C

3 4 equal sides and no right angles



A B C

4 4 sides; no right angles



A B C

Classify rectangles and squares · Workbook

Use the directions and shapes on each page. An adult can read the directions aloud.

Name: _____ Date: _____

Robot Parts Tray

Tick every box that fits the tile. A tile may fit both or neither.

A rectangle is a quadrilateral with four right angles.
A square is a rectangle with four equal sides.
A quadrilateral is a polygon with four straight sides.

		Rectangle	4 sides of one length
1		☑	☐
2		☐	☑
3		☑	☑
4		☐	☐
5		☑	☑
6		☐	☑

Classify rectangles and squares · Workbook

Use the directions and shapes on each page. An adult can read the directions aloud.

Name: _____ Date: _____

Label Audit

Does each label fit the tile? Tick Yes or No.

A rectangle is a quadrilateral with four right angles.
A square is a rectangle with four equal sides.
A quadrilateral is a polygon with four straight sides.

			Yes	No
1		Rectangle	☑	☐
2		Square	☐	☑
3		Quadrilateral	☐	☑
4		Triangle	☑	☐