Read equal-side and right-angle marks · Workbook

Use the directions and shapes on each page. An adult can read the directions aloud.

Name: _____ Date: _____

Tile Inspector

Circle the tile that fits both parts of the clue.

Matching ticks show equal lengths. A small square marks a right angle.

1 3 sides and 1 right angle

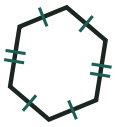

A

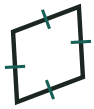

B



C

2 4 sides and no right angles



A

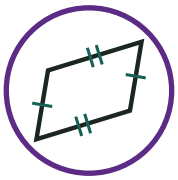

B



C

3 4 equal sides and no right angles

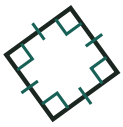

A

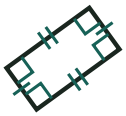

B

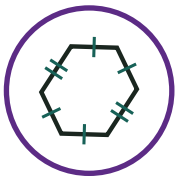

C

4 4 right angles and 2 side lengths

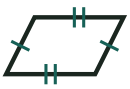

A

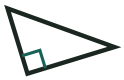

B

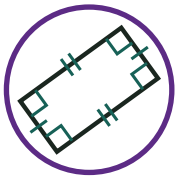

C

Read equal-side and right-angle marks · Workbook

Use the directions and shapes on each page. An adult can read the directions aloud.

Name: _____ Date: _____

Robot Parts Tray

Find the largest group of equal sides. Tick one box in each row.

Matching ticks show equal lengths. A small square marks a right angle.

		4 sides of one length	Largest group: 1 to 3
1	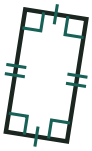	☐	☑
2	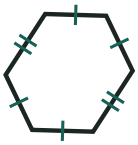	☑	☐
3	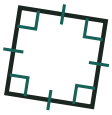	☑	☐
4		☐	☑
5	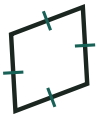	☑	☐
6		☐	☑

Read equal-side and right-angle marks · Workbook

Use the directions and shapes on each page. An adult can read the directions aloud.

Name: _____ Date: _____

Shape Notebook

Count the right angles. Write the size of the largest group of equal sides.

Matching ticks show equal lengths. A small square marks a right angle.
If no sides are the same length, write 1.

		Right angles	Largest equal group
1	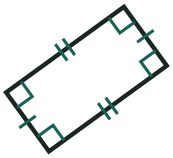	4	2
2	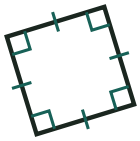	4	4
3		1	1
4	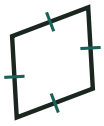	0	4