Equal rows and groups · Workbook 01

Each row is an equal group. Count the squares and complete the repeated addition in the box.

Name: _____

Date: _____

4 + 4 = 8



2 + 2 + 2 = 6



2 + 2 = 4



4 + 4 + 4 + 4 = 16



3 + 3 = 6



5 + 5 + 5 + 5 + 5 = 25



Equal rows and groups · Workbook 01

Each row is an equal group. Count the squares and complete the repeated addition in the box.

Name: _____ Date: _____

4 = 4

□ □ □ □

1 + 1 + 1 + 1 = 4

□
□
□
□

2 + 2 = 4

□ □
□ □

3 = 3

□ □ □

3 + 3 = 6

□ □ □
□ □ □

5 + 5 = 10

□ □ □ □ □
□ □ □ □ □

Equal rows and groups · Workbook 01

Each row is an equal group. Count the squares and complete the repeated addition in the box.

Name: _____

Date: _____

3 + 3 + 3 + 3 + 3 = 15



5 + 5 + 5 = 15



1 = 1



4 + 4 + 4 + 4 = 16



3 = 3



5 + 5 + 5 + 5 + 5 = 25



Equal rows and groups · Workbook 01

Each row is an equal group. Count the squares and complete the repeated addition in the box.

Name: _____

Date: _____

3 + 3 + 3 + 3 + 3 = 15



5 + 5 + 5 + 5 + 5 = 25



3 + 3 + 3 = 9



5 = 5



2 + 2 = 4



4 + 4 + 4 + 4 + 4 = 20



Equal rows and groups · Workbook 01

Each row is an equal group. Count the squares and complete the repeated addition in the box.

Name: _____

Date: _____

5 + 5 + 5 + 5 + 5 = 25



4 + 4 = 8



3 + 3 + 3 + 3 + 3 = 15



3 + 3 + 3 = 9



2 + 2 = 4



4 + 4 + 4 + 4 + 4 = 20

