Equal rows and groups · Workbook 01

Each row is an equal group. Count the squares and complete the repeated addition in the box.

Name: _____

Date: _____

4 + 4 = ☐



2 + 2 + 2 = ☐



2 + 2 = ☐



4 + 4 + 4 + 4 = ☐



3 + 3 = ☐



5 + 5 + 5 + 5 + 5 = ☐



Equal rows and groups · Workbook 01

Each row is an equal group. Count the squares and complete the repeated addition in the box.

Name: _____

Date: _____

4 = ☐

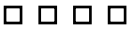

1 + 1 + 1 + 1 = ☐



2 + 2 = ☐



3 = ☐



3 + 3 = ☐



5 + 5 = ☐



Equal rows and groups · Workbook 01

Each row is an equal group. Count the squares and complete the repeated addition in the box.

Name: _____

Date: _____

3 + 3 + 3 + 3 + 3 = ☐



5 + 5 + 5 = ☐



1 = ☐



4 + 4 + 4 + 4 = ☐



3 = ☐



5 + 5 + 5 + 5 + 5 = ☐



Equal rows and groups · Workbook 01

Each row is an equal group. Count the squares and complete the repeated addition in the box.

Name: _____

Date: _____

3 + 3 + 3 + 3 + 3 = ☐



5 + 5 + 5 + 5 + 5 = ☐



3 + 3 + 3 = ☐



5 = ☐



2 + 2 = ☐



4 + 4 + 4 + 4 + 4 = ☐



Equal rows and groups · Workbook 01

Each row is an equal group. Count the squares and complete the repeated addition in the box.

Name: _____

Date: _____

5 + 5 + 5 + 5 + 5 = ☐



4 + 4 = ☐



3 + 3 + 3 + 3 + 3 = ☐



3 + 3 + 3 = ☐



2 + 2 = ☐



4 + 4 + 4 + 4 + 4 = ☐

