Compare centimetres and millimetres · Workbook

Use the pictures on the page. An adult can read the directions aloud.

Name: _____ Date: _____

Bridge Ribbons

Write the letter of the longer ribbon. 1 cm = 10 mm.

1

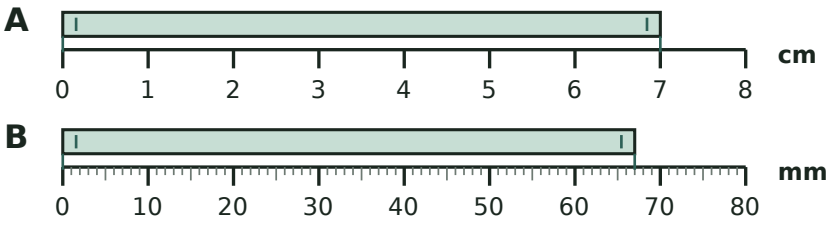

A

2

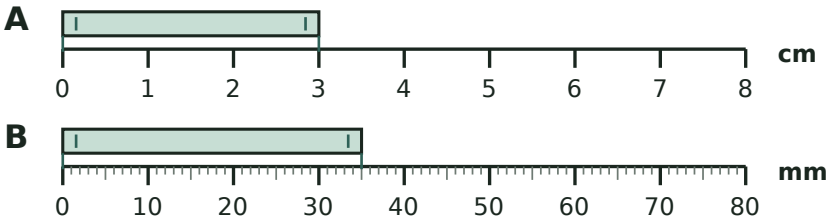

B

3

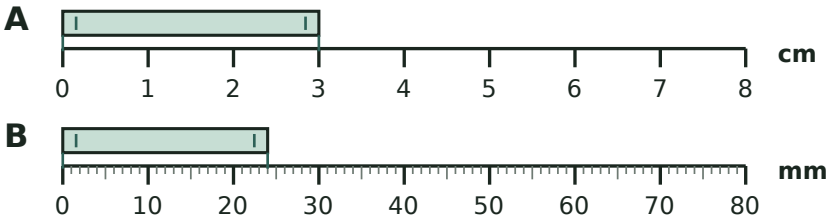

A

4

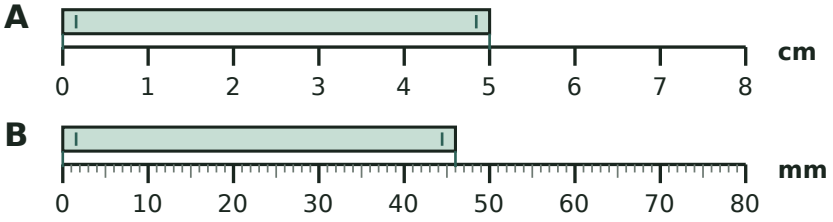

A

Compare centimetres and millimetres · Workbook

Use the pictures on the page. An adult can read the directions aloud.

Name: _____ Date: _____

Build a Walkway

Write the letters of the two pieces that fit. 1 cm = 10 mm.

1



A 3 cm

B 38 mm

C 21 mm

D 27 mm

A B

2



A 38 mm

B 27 mm

C 21 mm

D 3 cm

B D

3



A 21 mm

B 3 cm

C 38 mm

D 27 mm

A B

4



A 16 mm

B 2 cm

C 33 mm

D 22 mm

B D
