Measure from a different starting mark · Workbook

Use the pictures on the page. An adult can read the directions aloud.

Name: _____ Date: _____

Bridge Ribbons

Read both ends. How long is the ribbon?

1



9 cm

2



6 cm

3



7 cm

4

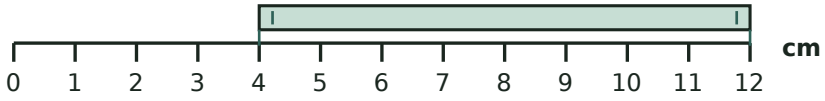

8 cm

Measure from a different starting mark · Workbook

Use the pictures on the page. An adult can read the directions aloud.

Name: _____ Date: _____

Build a Walkway

How long is the missing piece?

1



3 cm

2



2 cm

3



6 cm

4



8 cm
