Compara fracciones · Cuaderno 02

Las dos barras representan enteros del mismo tamaño. Compara las fracciones grises. Escribe <, = o > en el recuadro.

Nombre: _____ Fecha: _____

1.

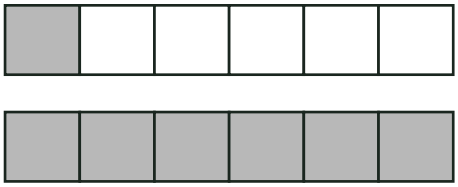

1/6 < 6/6

2.

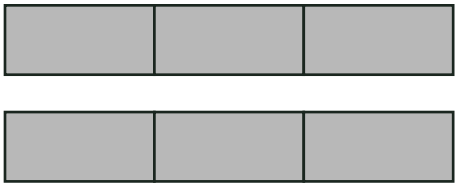

3/3 = 3/3

3.

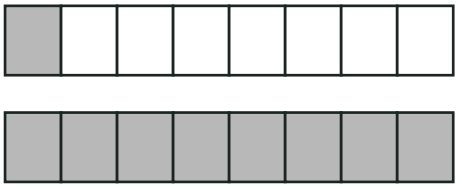

1/8 < 8/8

4.

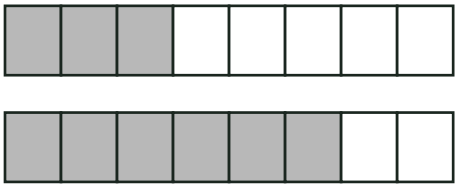

3/8 < 6/8

5.

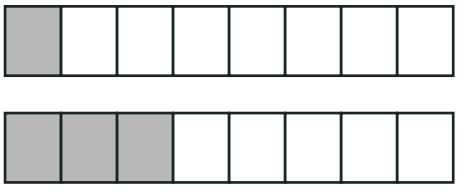

1/8 < 3/8

6.

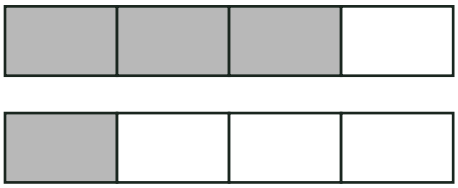

3/4 > 1/4

Compara fracciones · Cuaderno 02

Las dos barras representan enteros del mismo tamaño. Compara las fracciones grises. Escribe <, = o > en el recuadro.

Nombre: _____ Fecha: _____

1.

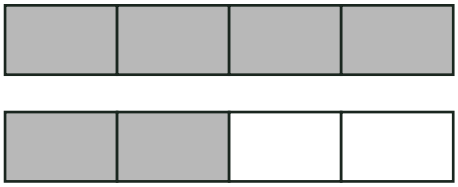

4/4 [>] 2/4

2.

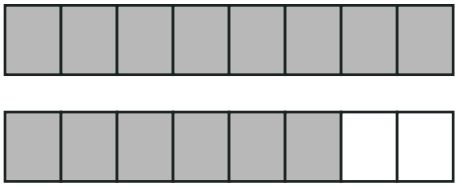

8/8 [>] 6/8

3.

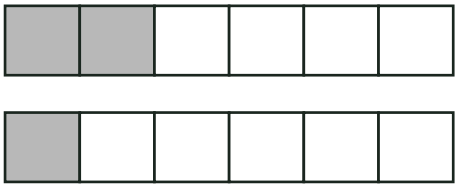

2/6 [>] 1/6

4.

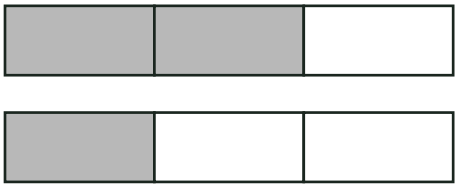

2/3 [>] 1/3

5.

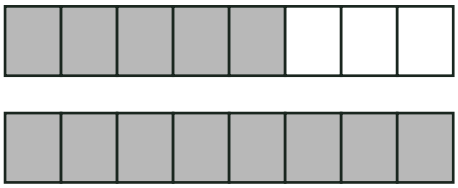

5/8 [<] 8/8

6.

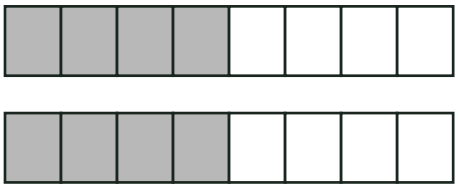

4/8 [=] 4/8

Compara fracciones · Cuaderno 02

Las dos barras representan enteros del mismo tamaño. Compara las fracciones grises. Escribe <, = o > en el recuadro.

Nombre: _____ Fecha: _____

1.

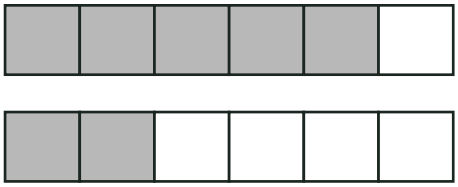

5/6 [>] 2/6

2.

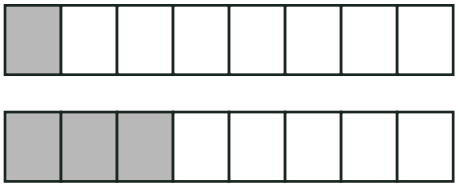

1/8 [<] 3/8

3.

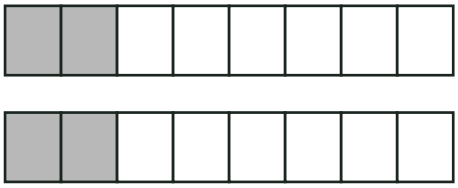

2/8 [=] 2/8

4.

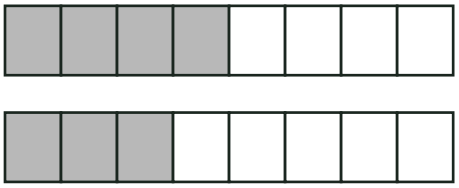

4/8 [>] 3/8

5.

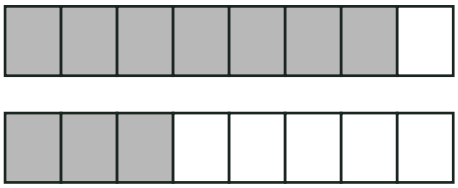

7/8 [>] 3/8

6.

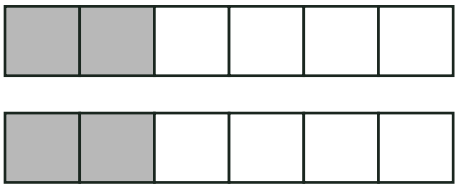

2/6 [=] 2/6

Compara fracciones · Cuaderno 02

Las dos barras representan enteros del mismo tamaño. Compara las fracciones grises. Escribe <, = o > en el recuadro.

Nombre: _____ Fecha: _____

1.

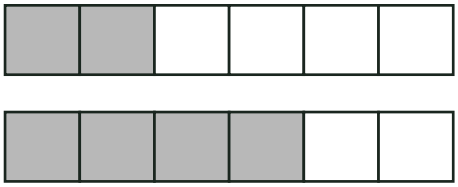

2/6 **<** 4/6

2.

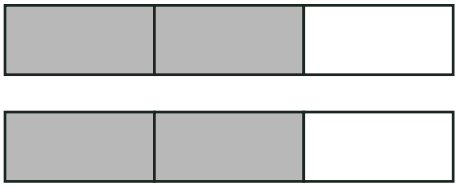

2/3 **=** 2/3

3.

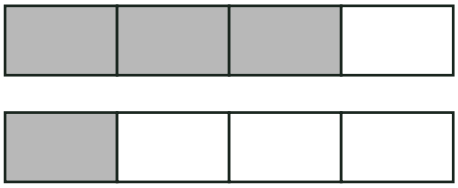

3/4 **>** 1/4

4.

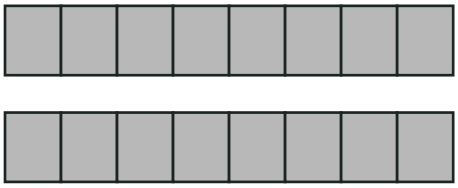

8/8 **=** 8/8

5.

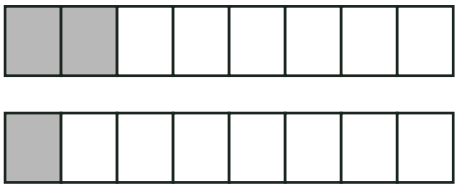

2/8 **>** 1/8

6.

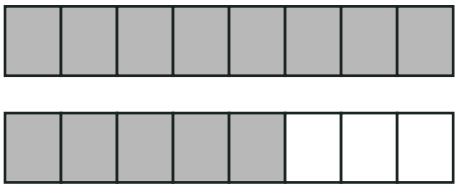

8/8 **>** 5/8

Compara fracciones · Cuaderno 02

Las dos barras representan enteros del mismo tamaño. Compara las fracciones grises. Escribe <, = o > en el recuadro.

Nombre: _____ Fecha: _____

1.

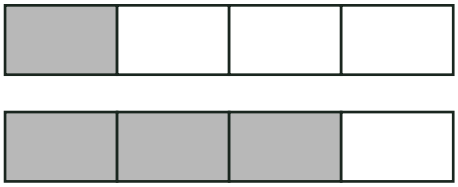

1/4 < 3/4

2.

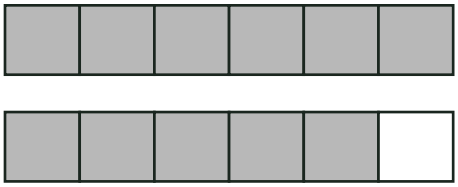

6/6 > 5/6

3.

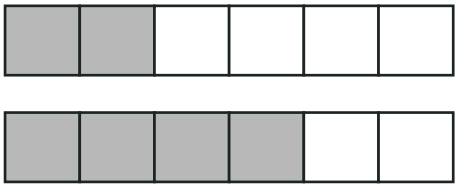

2/6 < 4/6

4.

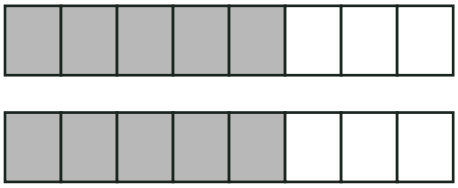

5/8 = 5/8

5.

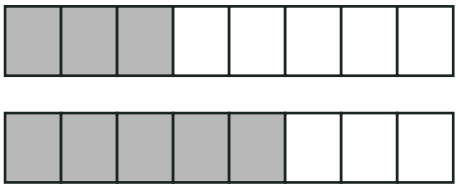

3/8 < 5/8

6.

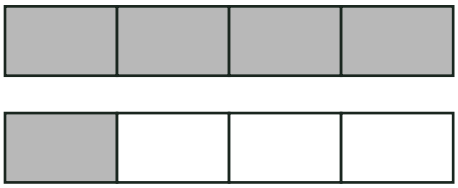

4/4 > 1/4