Compare fractions · Workbook 02

Both bars represent the same-sized whole. Compare the grey fractions. Write <, = or > in the box.

Name: _____

Date: _____

1.

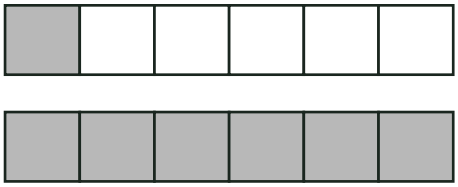

1/6 < 6/6

2.

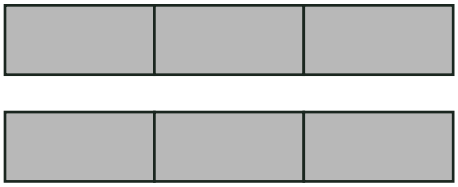

3/3 = 3/3

3.

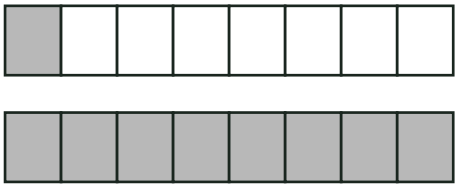

1/8 < 8/8

4.

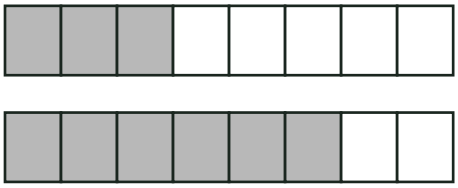

3/8 < 6/8

5.

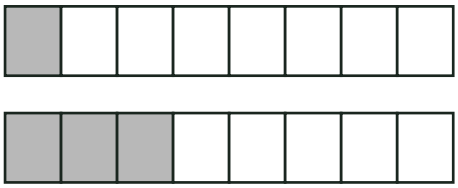

1/8 < 3/8

6.

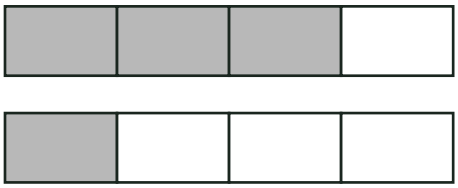

3/4 > 1/4

Compare fractions · Workbook 02

Both bars represent the same-sized whole. Compare the grey fractions. Write <, = or > in the box.

Name: _____

Date: _____

1.

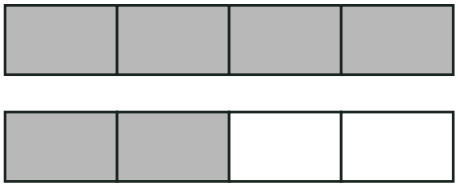

4/4 > 2/4

2.

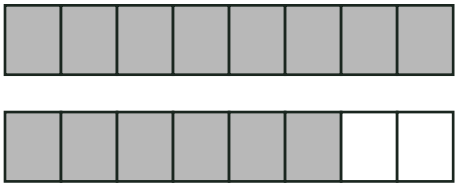

8/8 > 6/8

3.

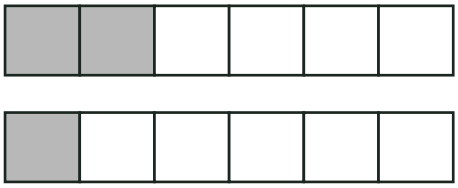

2/6 > 1/6

4.

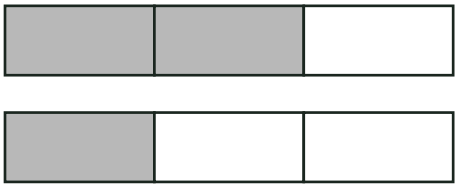

2/3 > 1/3

5.

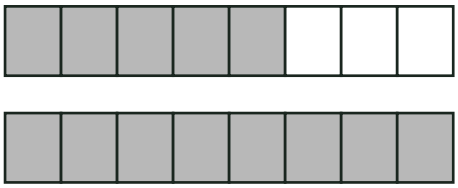

5/8 < 8/8

6.

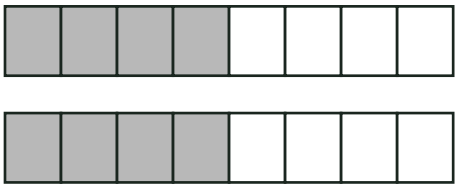

4/8 = 4/8

Compare fractions · Workbook 02

Both bars represent the same-sized whole. Compare the grey fractions. Write <, = or > in the box.

Name: _____

Date: _____

1.





5/6 > 2/6

2.





1/8 < 3/8

3.





2/8 = 2/8

4.





4/8 > 3/8

5.





7/8 > 3/8

6.





2/6 = 2/6

Compare fractions · Workbook 02

Both bars represent the same-sized whole. Compare the grey fractions. Write <, = or > in the box.

Name: _____

Date: _____

1.





2/6 [<] 4/6

2.





2/3 [=] 2/3

3.





3/4 [>] 1/4

4.





8/8 [=] 8/8

5.





2/8 [>] 1/8

6.





8/8 [>] 5/8

Compare fractions · Workbook 02

Both bars represent the same-sized whole. Compare the grey fractions. Write <, = or > in the box.

Name: _____

Date: _____

1.

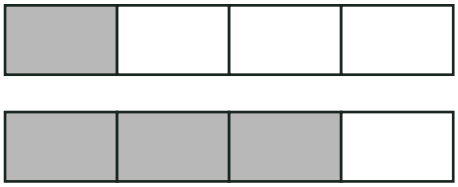

1/4 < 3/4

2.

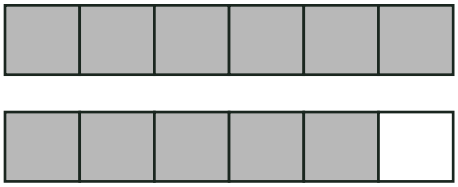

6/6 > 5/6

3.

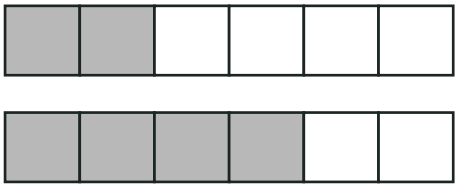

2/6 < 4/6

4.

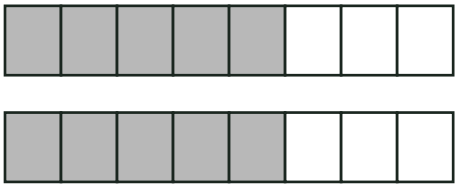

5/8 = 5/8

5.

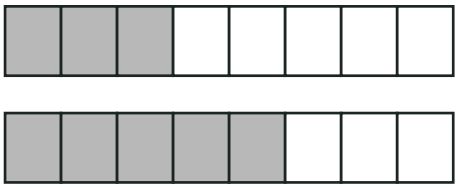

3/8 < 5/8

6.

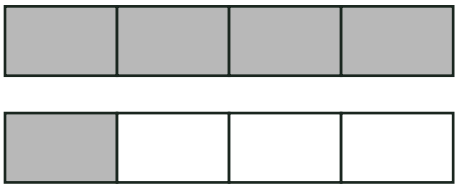

4/4 > 1/4