Vergleiche Brüche · Übungsheft 02

Beide Streifen stellen gleich große Ganze dar. Vergleiche die grauen Brüche. Schreibe <, = oder > ins Feld.

Name: _____ Datum: _____

1.

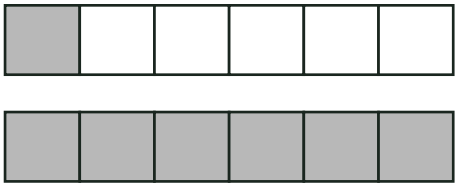

1/6 < 6/6

2.

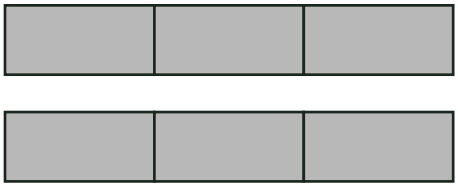

3/3 = 3/3

3.

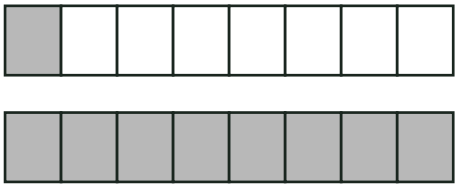

1/8 < 8/8

4.

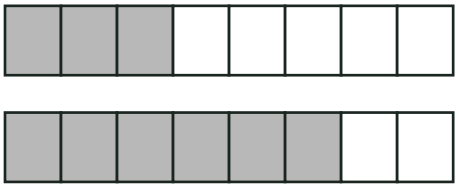

3/8 < 6/8

5.

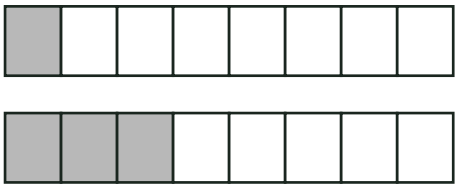

1/8 < 3/8

6.

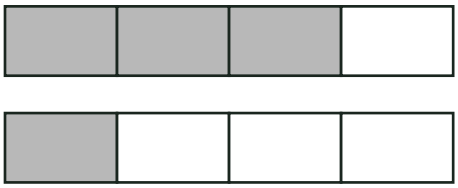

3/4 > 1/4

Vergleiche Brüche · Übungsheft 02

Beide Streifen stellen gleich große Ganze dar. Vergleiche die grauen Brüche. Schreibe <, = oder > ins Feld.

Name: _____ Datum: _____

1.

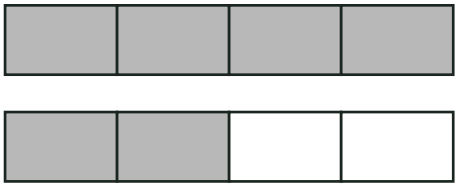

4/4 **>** 2/4

2.

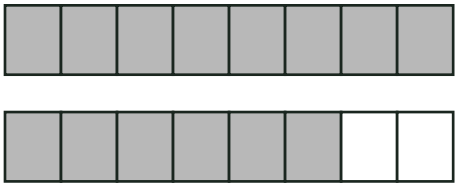

8/8 **>** 6/8

3.

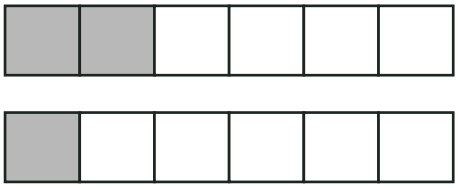

2/6 **>** 1/6

4.

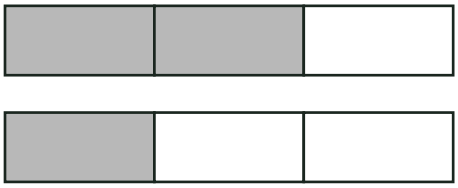

2/3 **>** 1/3

5.

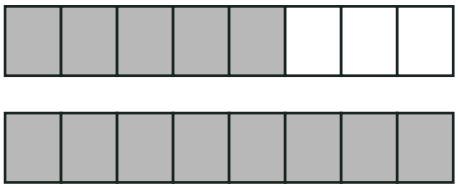

5/8 **<** 8/8

6.

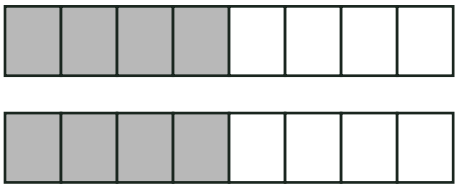

4/8 **=** 4/8

Vergleiche Brüche · Übungsheft 02

Beide Streifen stellen gleich große Ganze dar. Vergleiche die grauen Brüche. Schreibe <, = oder > ins Feld.

Name: _____ Datum: _____

1.

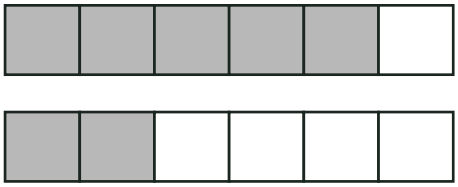

5/6 **>** 2/6

2.

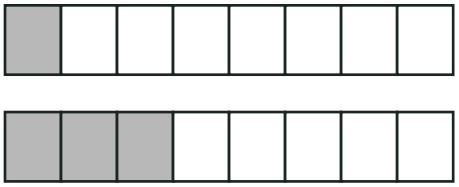

1/8 **<** 3/8

3.

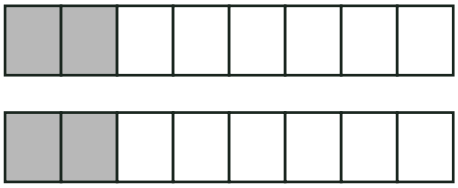

2/8 **=** 2/8

4.

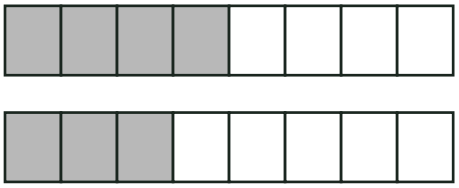

4/8 **>** 3/8

5.

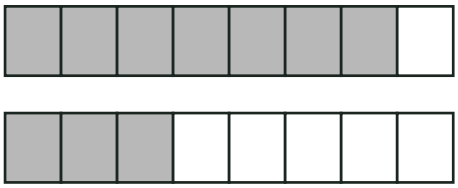

7/8 **>** 3/8

6.

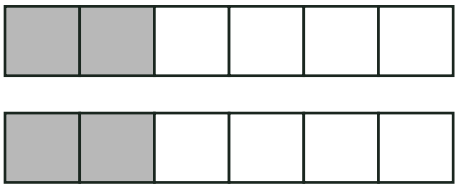

2/6 **=** 2/6

Vergleiche Brüche · Übungsheft 02

Beide Streifen stellen gleich große Ganze dar. Vergleiche die grauen Brüche. Schreibe <, = oder > ins Feld.

Name: _____ Datum: _____

1.

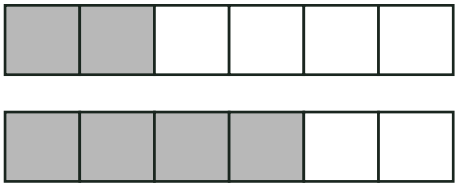

2/6 **<** 4/6

2.

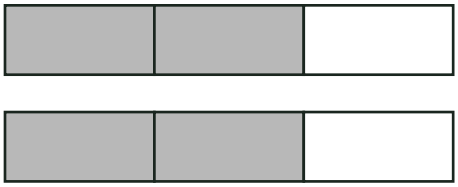

2/3 **=** 2/3

3.

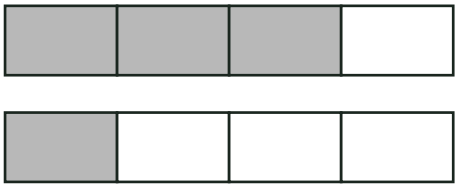

3/4 **>** 1/4

4.

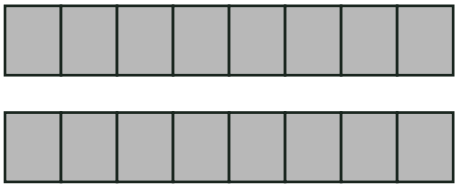

8/8 **=** 8/8

5.

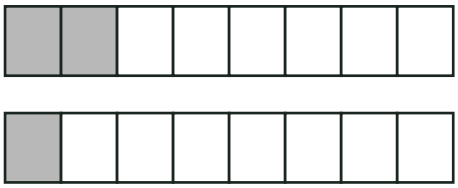

2/8 **>** 1/8

6.

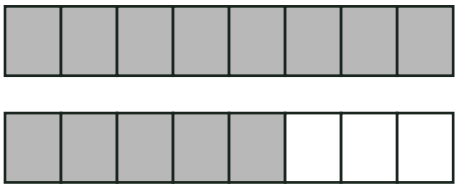

8/8 **>** 5/8

Vergleiche Brüche · Übungsheft 02

Beide Streifen stellen gleich große Ganze dar. Vergleiche die grauen Brüche. Schreibe <, = oder > ins Feld.

Name: _____ Datum: _____

1.

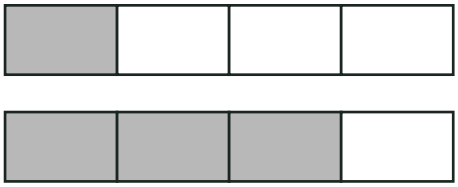

1/4 **<** 3/4

2.

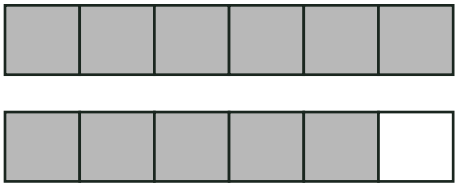

6/6 **>** 5/6

3.

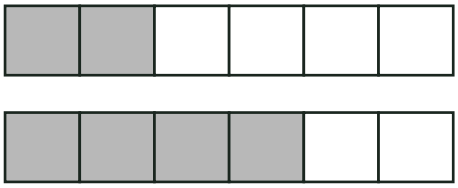

2/6 **<** 4/6

4.

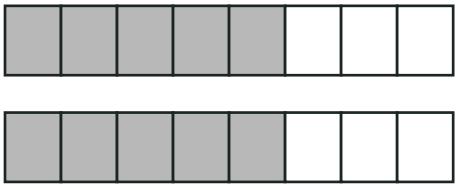

5/8 **=** 5/8

5.

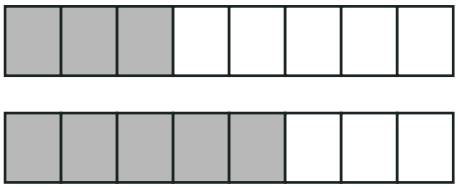

3/8 **<** 5/8

6.

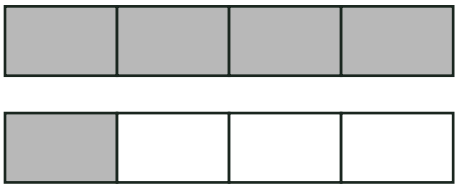

4/4 **>** 1/4