Sharing into equal groups · Workbook 01

Each row is an equal group. Count the squares in each row. Divide the total by the number of rows and write how many are in each group.

Name: _____ Date: _____

20 ÷ 5 = **4**



10 ÷ 2 = **5**



8 ÷ 4 = **2**



12 ÷ 3 = **4**



10 ÷ 5 = **2**



6 ÷ 2 = **3**



Sharing into equal groups · Workbook 01

Each row is an equal group. Count the squares in each row. Divide the total by the number of rows and write how many are in each group.

Name: _____ Date: _____

9 ÷ 3 = **3**



6 ÷ 3 = **2**



4 ÷ 2 = **2**



8 ÷ 4 = **2**



2 ÷ 2 = **1**



10 ÷ 2 = **5**



Sharing into equal groups · Workbook 01

Each row is an equal group. Count the squares in each row. Divide the total by the number of rows and write how many are in each group.

Name: _____ Date: _____

$2 \div 2 =$ **1**



$6 \div 2 =$ **3**



$8 \div 4 =$ **2**



$20 \div 4 =$ **5**



$4 \div 4 =$ **1**



$8 \div 2 =$ **4**



Sharing into equal groups · Workbook 01

Each row is an equal group. Count the squares in each row. Divide the total by the number of rows and write how many are in each group.

Name: _____

Date: _____

5 ÷ 5 = **1**



8 ÷ 4 = **2**



20 ÷ 5 = **4**



4 ÷ 4 = **1**



6 ÷ 2 = **3**



12 ÷ 3 = **4**



Sharing into equal groups · Workbook 01

Each row is an equal group. Count the squares in each row. Divide the total by the number of rows and write how many are in each group.

Name: _____

Date: _____

20 ÷ 5 = **4**



16 ÷ 4 = **4**



12 ÷ 3 = **4**



6 ÷ 3 = **2**



4 ÷ 2 = **2**



3 ÷ 3 = **1**

