Lire les heures entières · Cahier 01

Lis les heures entières. La petite aiguille indique les heures, la grande les minutes. Écris une heure de 1 à 12. Le moment de la journée est indiqué.

Prénom: _____ Date: _____

À partir de midi



3 h

Avant midi



11 h

À partir de midi



6 h

À partir de midi



2 h

À partir de midi



8 h

À partir de midi



7 h

Lire les heures entières · Cahier 01

Lis les heures entières. La petite aiguille indique les heures, la grande les minutes. Écris une heure de 1 à 12. Le moment de la journée est indiqué.

Prénom: _____ Date: _____

Avant midi



6 h

Avant midi



9 h

À partir de midi



7 h

À partir de midi



2 h

À partir de midi



3 h

Avant midi



10 h

Lire les heures entières · Cahier 01

Lis les heures entières. La petite aiguille indique les heures, la grande les minutes. Écris une heure de 1 à 12. Le moment de la journée est indiqué.

Prénom: _____ Date: _____

À partir de midi



12 h

Avant midi



10 h

À partir de midi



8 h

Avant midi



8 h

À partir de midi



4 h

À partir de midi



1 h

Lire les heures entières · Cahier 01

Lis les heures entières. La petite aiguille indique les heures, la grande les minutes. Écris une heure de 1 à 12. Le moment de la journée est indiqué.

Prénom: _____ Date: _____

Avant midi



6 h

Avant midi



8 h

À partir de midi



8 h

À partir de midi



3 h

À partir de midi



6 h

À partir de midi



12 h

Lire les heures entières · Cahier 01

Lis les heures entières. La petite aiguille indique les heures, la grande les minutes. Écris une heure de 1 à 12. Le moment de la journée est indiqué.

Prénom: _____ Date: _____

Avant midi



9 h

Avant midi



7 h

À partir de midi



1 h

Avant midi



11 h

À partir de midi



12 h

À partir de midi



3 h