Lire les heures entières · Cahier 01

Lis les heures entières. La petite aiguille indique les heures, la grande les minutes. Écris une heure de 1 à 12. Le moment de la journée est indiqué.

Prénom: _____ Date: _____

À partir de midi



Avant midi



À partir de midi



À partir de midi



À partir de midi



À partir de midi



Lire les heures entières · Cahier 01

Lis les heures entières. La petite aiguille indique les heures, la grande les minutes. Écris une heure de 1 à 12. Le moment de la journée est indiqué.

Prénom: _____ Date: _____

Avant midi



Avant midi



À partir de midi



À partir de midi



À partir de midi



Avant midi



Lire les heures entières · Cahier 01

Lis les heures entières. La petite aiguille indique les heures, la grande les minutes. Écris une heure de 1 à 12. Le moment de la journée est indiqué.

Prénom: _____ Date: _____

À partir de midi



Avant midi



À partir de midi



Avant midi



À partir de midi



À partir de midi



Lire les heures entières · Cahier 01

Lis les heures entières. La petite aiguille indique les heures, la grande les minutes. Écris une heure de 1 à 12. Le moment de la journée est indiqué.

Prénom: _____ Date: _____

Avant midi



Avant midi



À partir de midi



À partir de midi



À partir de midi



À partir de midi



Lire les heures entières · Cahier 01

Lis les heures entières. La petite aiguille indique les heures, la grande les minutes. Écris une heure de 1 à 12. Le moment de la journée est indiqué.

Prénom: _____ Date: _____

Avant midi



Avant midi



À partir de midi



Avant midi



À partir de midi



À partir de midi

