Reading whole hours · Workbook 01

Read the whole hour. The short hand shows hours; the long hand shows minutes. Use a.m. or p.m. as indicated.

Name: _____ Date: _____

p.m.



3:00 p.m.

a.m.



11:00 a.m.

p.m.



6:00 p.m.

p.m.



2:00 p.m.

p.m.



8:00 p.m.

p.m.



7:00 p.m.

Reading whole hours · Workbook 01

Read the whole hour. The short hand shows hours; the long hand shows minutes. Use a.m. or p.m. as indicated.

Name: _____ Date: _____

a.m.



6:00 a.m.

a.m.



9:00 a.m.

p.m.



7:00 p.m.

p.m.



2:00 p.m.

p.m.



3:00 p.m.

a.m.



10:00 a.m.

Reading whole hours · Workbook 01

Read the whole hour. The short hand shows hours; the long hand shows minutes. Use a.m. or p.m. as indicated.

Name: _____ Date: _____

p.m.



12:00 p.m.

a.m.



10:00 a.m.

p.m.



8:00 p.m.

a.m.



8:00 a.m.

p.m.



4:00 p.m.

p.m.



1:00 p.m.

Reading whole hours · Workbook 01

Read the whole hour. The short hand shows hours; the long hand shows minutes. Use a.m. or p.m. as indicated.

Name: _____ Date: _____

a.m.



6:00 a.m.

a.m.



8:00 a.m.

p.m.



8:00 p.m.

p.m.



3:00 p.m.

p.m.



6:00 p.m.

p.m.



12:00 p.m.

Reading whole hours · Workbook 01

Read the whole hour. The short hand shows hours; the long hand shows minutes. Use a.m. or p.m. as indicated.

Name: _____ Date: _____

a.m.



9:00 a.m.

a.m.



7:00 a.m.

p.m.



1:00 p.m.

a.m.



11:00 a.m.

p.m.



12:00 p.m.

p.m.



3:00 p.m.