Reading whole hours · Workbook 01

Read the whole hour. The short hand shows hours; the long hand shows minutes. Use a.m. or p.m. as indicated.

Name: _____ Date: _____

p.m.



a.m.



p.m.



p.m.



p.m.



p.m.



Reading whole hours · Workbook 01

Read the whole hour. The short hand shows hours; the long hand shows minutes. Use a.m. or p.m. as indicated.

Name: _____ Date: _____

a.m.



a.m.



p.m.



p.m.



p.m.



a.m.



Reading whole hours · Workbook 01

Read the whole hour. The short hand shows hours; the long hand shows minutes. Use a.m. or p.m. as indicated.

Name: _____ Date: _____

p.m.



a.m.



p.m.



a.m.



p.m.



p.m.



Reading whole hours · Workbook 01

Read the whole hour. The short hand shows hours; the long hand shows minutes. Use a.m. or p.m. as indicated.

Name: _____ Date: _____

a.m.



a.m.



p.m.



p.m.



p.m.



p.m.



Reading whole hours · Workbook 01

Read the whole hour. The short hand shows hours; the long hand shows minutes. Use a.m. or p.m. as indicated.

Name: _____ Date: _____

a.m.



a.m.



p.m.



a.m.



p.m.



p.m.

