Quarter-hour time steps · Workbook 03

Read the start time and add the shown minutes. Use steps of 15 minutes. Write the finish time with a.m. or p.m.

Name: _____ Date: _____

p.m.



+ 90 min

2:30 p.m.
14:30

p.m.



+ 30 min

5:45 p.m.
17:45

a.m.



+ 30 min

6:30 a.m.
06:30

p.m.



+ 75 min

5:15 p.m.
17:15

a.m.



+ 45 min

8:45 a.m.
08:45

p.m.



+ 75 min

6:00 p.m.
18:00

Quarter-hour time steps · Workbook 03

Read the start time and add the shown minutes. Use steps of 15 minutes. Write the finish time with a.m. or p.m.

Name: _____ Date: _____

p.m.



+ 75 min

5:30 p.m.
17:30

p.m.



+ 75 min

7:00 p.m.
19:00

p.m.



+ 60 min

8:00 p.m.
20:00

p.m.



+ 15 min

3:45 p.m.
15:45

p.m.



+ 30 min

5:15 p.m.
17:15

a.m.



+ 15 min

8:00 a.m.
08:00

Quarter-hour time steps · Workbook 03

Read the start time and add the shown minutes. Use steps of 15 minutes. Write the finish time with a.m. or p.m.

Name: _____ Date: _____

p.m.



+ 90 min

3:15 p.m.
15:15

a.m.



+ 90 min

7:30 a.m.
07:30

p.m.



+ 90 min

9:15 p.m.
21:15

a.m.



+ 15 min

10:30 a.m.
10:30

p.m.



+ 15 min

4:45 p.m.
16:45

a.m.



+ 30 min

8:30 a.m.
08:30

Quarter-hour time steps · Workbook 03

Read the start time and add the shown minutes. Use steps of 15 minutes. Write the finish time with a.m. or p.m.

Name: _____ Date: _____

p.m.



+ 60 min

6:15 p.m.
18:15

p.m.



+ 30 min

4:00 p.m.
16:00

p.m.



+ 15 min

12:45 p.m.
12:45

a.m.



+ 45 min

9:45 a.m.
09:45

p.m.



+ 45 min

5:00 p.m.
17:00

a.m.



+ 45 min

6:45 a.m.
06:45

Quarter-hour time steps · Workbook 03

Read the start time and add the shown minutes. Use steps of 15 minutes. Write the finish time with a.m. or p.m.

Name: _____ Date: _____

a.m.



+ 60 min

10:30 a.m.
10:30

a.m.



+ 60 min

11:30 a.m.
11:30

a.m.



+ 75 min

11:00 a.m.
11:00

a.m.



+ 90 min

8:45 a.m.
08:45

p.m.



+ 90 min

10:00 p.m.
22:00

p.m.



+ 15 min

6:00 p.m.
18:00