Quarter-hour time steps · Workbook 03

Read the start time and add the shown minutes. Use steps of 15 minutes. Write the finish time with a.m. or p.m.

Name: _____ Date: _____

p.m.



+ 90 min

p.m.



+ 30 min

a.m.



+ 30 min

p.m.



+ 75 min

a.m.



+ 45 min

p.m.



+ 75 min

Quarter-hour time steps · Workbook 03

Read the start time and add the shown minutes. Use steps of 15 minutes. Write the finish time with a.m. or p.m.

Name: _____ Date: _____

p.m.



+ 75 min

p.m.



+ 75 min

p.m.



+ 60 min

p.m.



+ 15 min

p.m.



+ 30 min

a.m.



+ 15 min

Quarter-hour time steps · Workbook 03

Read the start time and add the shown minutes. Use steps of 15 minutes. Write the finish time with a.m. or p.m.

Name: _____ Date: _____

p.m.



+ 90 min

a.m.



+ 90 min

p.m.



+ 90 min

a.m.



+ 15 min

p.m.



+ 15 min

a.m.



+ 30 min

Quarter-hour time steps · Workbook 03

Read the start time and add the shown minutes. Use steps of 15 minutes. Write the finish time with a.m. or p.m.

Name: _____ Date: _____

p.m.



+ 60 min

p.m.



+ 30 min

p.m.



+ 15 min

a.m.



+ 45 min

p.m.



+ 45 min

a.m.



+ 45 min

Quarter-hour time steps · Workbook 03

Read the start time and add the shown minutes. Use steps of 15 minutes. Write the finish time with a.m. or p.m.

Name: _____ Date: _____

a.m.



+ 60 min

a.m.



+ 60 min

a.m.



+ 75 min

a.m.



+ 90 min

p.m.



+ 90 min

p.m.



+ 15 min