Viertelstunden addieren · Übungsheft 03

Lies die Startzeit ab und addiere die angegebenen Minuten in Viertelstundenschritten. Schreibe die Endzeit im 24-Stunden-Format auf.

Name: _____ Datum: _____

Ab 12 Uhr



+ 90 min

14:30 Uhr
2:30 p.m.

Ab 12 Uhr



+ 30 min

17:45 Uhr
5:45 p.m.

Vor 12 Uhr



+ 30 min

06:30 Uhr
6:30 a.m.

Ab 12 Uhr



+ 75 min

17:15 Uhr
5:15 p.m.

Vor 12 Uhr



+ 45 min

08:45 Uhr
8:45 a.m.

Ab 12 Uhr



+ 75 min

18:00 Uhr
6:00 p.m.

Viertelstunden addieren · Übungsheft 03

Lies die Startzeit ab und addiere die angegebenen Minuten in Viertelstundenschritten. Schreibe die Endzeit im 24-Stunden-Format auf.

Name: _____ Datum: _____

Ab 12 Uhr



+ 75 min

17:30 Uhr
5:30 p.m.

Ab 12 Uhr



+ 75 min

19:00 Uhr
7:00 p.m.

Ab 12 Uhr



+ 60 min

20:00 Uhr
8:00 p.m.

Ab 12 Uhr



+ 15 min

15:45 Uhr
3:45 p.m.

Ab 12 Uhr



+ 30 min

17:15 Uhr
5:15 p.m.

Vor 12 Uhr



+ 15 min

08:00 Uhr
8:00 a.m.

Viertelstunden addieren · Übungsheft 03

Lies die Startzeit ab und addiere die angegebenen Minuten in Viertelstundenschritten. Schreibe die Endzeit im 24-Stunden-Format auf.

Name: _____ Datum: _____

Ab 12 Uhr



+ 90 min

15:15 Uhr
3:15 p.m.

Vor 12 Uhr



+ 90 min

07:30 Uhr
7:30 a.m.

Ab 12 Uhr



+ 90 min

21:15 Uhr
9:15 p.m.

Vor 12 Uhr



+ 15 min

10:30 Uhr
10:30 a.m.

Ab 12 Uhr



+ 15 min

16:45 Uhr
4:45 p.m.

Vor 12 Uhr



+ 30 min

08:30 Uhr
8:30 a.m.

Viertelstunden addieren · Übungsheft 03

Lies die Startzeit ab und addiere die angegebenen Minuten in Viertelstundenschritten. Schreibe die Endzeit im 24-Stunden-Format auf.

Name: _____ Datum: _____

Ab 12 Uhr



+ 60 min

18:15 Uhr
6:15 p.m.

Ab 12 Uhr



+ 30 min

16:00 Uhr
4:00 p.m.

Ab 12 Uhr



+ 15 min

12:45 Uhr
12:45 p.m.

Vor 12 Uhr



+ 45 min

09:45 Uhr
9:45 a.m.

Ab 12 Uhr



+ 45 min

17:00 Uhr
5:00 p.m.

Vor 12 Uhr



+ 45 min

06:45 Uhr
6:45 a.m.

Viertelstunden addieren · Übungsheft 03

Lies die Startzeit ab und addiere die angegebenen Minuten in Viertelstundenschritten. Schreibe die Endzeit im 24-Stunden-Format auf.

Name: _____ Datum: _____

Vor 12 Uhr



+ 60 min

10:30 Uhr
10:30 a.m.

Vor 12 Uhr



+ 60 min

11:30 Uhr
11:30 a.m.

Vor 12 Uhr



+ 75 min

11:00 Uhr
11:00 a.m.

Vor 12 Uhr



+ 90 min

08:45 Uhr
8:45 a.m.

Ab 12 Uhr



+ 90 min

22:00 Uhr
10:00 p.m.

Ab 12 Uhr



+ 15 min

18:00 Uhr
6:00 p.m.