Viertelstunden addieren · Übungsheft 03

Lies die Startzeit ab und addiere die angegebenen Minuten in Viertelstundenschritten. Schreibe die Endzeit im 24-Stunden-Format auf.

Name: _____ Datum: _____

Ab 12 Uhr



+ 90 min

Ab 12 Uhr



+ 30 min

Vor 12 Uhr



+ 30 min

Ab 12 Uhr



+ 75 min

Vor 12 Uhr



+ 45 min

Ab 12 Uhr



+ 75 min

Viertelstunden addieren · Übungsheft 03

Lies die Startzeit ab und addiere die angegebenen Minuten in Viertelstundenschritten. Schreibe die Endzeit im 24-Stunden-Format auf.

Name: _____ Datum: _____

Ab 12 Uhr



+ 75 min

Ab 12 Uhr



+ 75 min

Ab 12 Uhr



+ 60 min

Ab 12 Uhr



+ 15 min

Ab 12 Uhr



+ 30 min

Vor 12 Uhr



+ 15 min

Viertelstunden addieren · Übungsheft 03

Lies die Startzeit ab und addiere die angegebenen Minuten in Viertelstundenschritten. Schreibe die Endzeit im 24-Stunden-Format auf.

Name: _____ Datum: _____

Ab 12 Uhr



+ 90 min

Vor 12 Uhr



+ 90 min

Ab 12 Uhr



+ 90 min

Vor 12 Uhr



+ 15 min

Ab 12 Uhr



+ 15 min

Vor 12 Uhr



+ 30 min

Viertelstunden addieren · Übungsheft 03

Lies die Startzeit ab und addiere die angegebenen Minuten in Viertelstundenschritten. Schreibe die Endzeit im 24-Stunden-Format auf.

Name: _____ Datum: _____

Ab 12 Uhr



+ 60 min

Ab 12 Uhr



+ 30 min

Ab 12 Uhr



+ 15 min

Vor 12 Uhr



+ 45 min

Ab 12 Uhr



+ 45 min

Vor 12 Uhr



+ 45 min

Viertelstunden addieren · Übungsheft 03

Lies die Startzeit ab und addiere die angegebenen Minuten in Viertelstundenschritten. Schreibe die Endzeit im 24-Stunden-Format auf.

Name: _____ Datum: _____

Vor 12 Uhr



+ 60 min

Vor 12 Uhr



+ 60 min

Vor 12 Uhr



+ 75 min

Vor 12 Uhr



+ 90 min

Ab 12 Uhr



+ 90 min

Ab 12 Uhr



+ 15 min