Lire l'heure à la minute · Cahier 01

Lis l'heure à la minute. Chaque petite graduation vaut une minute. Tiens compte du moment indiqué et écris l'heure sur 24 heures.

Prénom: _____ Date: _____

À partir de midi



17 h 42
5:42 p.m.

À partir de midi



18 h 36
6:36 p.m.

À partir de midi



19 h 26
7:26 p.m.

Avant midi



06 h 11
6:11 a.m.

Avant midi



11 h 08
11:08 a.m.

Avant midi



10 h 29
10:29 a.m.

Lire l'heure à la minute · Cahier 01

Lis l'heure à la minute. Chaque petite graduation vaut une minute. Tiens compte du moment indiqué et écris l'heure sur 24 heures.

Prénom: _____ Date: _____

Avant midi



06 h 57
6:57 a.m.

À partir de midi



13 h 26
1:26 p.m.

À partir de midi



19 h 07
7:07 p.m.

À partir de midi



19 h 04
7:04 p.m.

Avant midi



09 h 31
9:31 a.m.

À partir de midi



12 h 51
12:51 p.m.

Lire l'heure à la minute · Cahier 01

Lis l'heure à la minute. Chaque petite graduation vaut une minute. Tiens compte du moment indiqué et écris l'heure sur 24 heures.

Prénom: _____ Date: _____

Avant midi



11 h 06
11:06 a.m.

À partir de midi



15 h 19
3:19 p.m.

Avant midi



09 h 17
9:17 a.m.

À partir de midi



20 h 47
8:47 p.m.

À partir de midi



16 h 09
4:09 p.m.

À partir de midi



14 h 53
2:53 p.m.

Lire l'heure à la minute · Cahier 01

Lis l'heure à la minute. Chaque petite graduation vaut une minute. Tiens compte du moment indiqué et écris l'heure sur 24 heures.

Prénom: _____ Date: _____

Avant midi



09 h 17
9:17 a.m.

Avant midi



06 h 17
6:17 a.m.

Avant midi



06 h 39
6:39 a.m.

Avant midi



08 h 08
8:08 a.m.

À partir de midi



12 h 17
12:17 p.m.

Avant midi



10 h 18
10:18 a.m.

Lire l'heure à la minute · Cahier 01

Lis l'heure à la minute. Chaque petite graduation vaut une minute. Tiens compte du moment indiqué et écris l'heure sur 24 heures.

Prénom: _____ Date: _____

À partir de midi



12 h 38
12:38 p.m.

À partir de midi



17 h 38
5:38 p.m.

Avant midi



09 h 51
9:51 a.m.

À partir de midi



12 h 51
12:51 p.m.

À partir de midi



18 h 16
6:16 p.m.

À partir de midi



14 h 41
2:41 p.m.