Lire l'heure à la minute · Cahier 01

Lis l'heure à la minute. Chaque petite graduation vaut une minute. Tiens compte du moment indiqué et écris l'heure sur 24 heures.

Prénom: _____ Date: _____

À partir de midi



À partir de midi



À partir de midi



Avant midi



Avant midi



Avant midi



Lire l'heure à la minute · Cahier 01

Lis l'heure à la minute. Chaque petite graduation vaut une minute. Tiens compte du moment indiqué et écris l'heure sur 24 heures.

Prénom: _____ Date: _____

Avant midi



À partir de midi



À partir de midi



À partir de midi



Avant midi



À partir de midi



Lire l'heure à la minute · Cahier 01

Lis l'heure à la minute. Chaque petite graduation vaut une minute. Tiens compte du moment indiqué et écris l'heure sur 24 heures.

Prénom: _____ Date: _____

Avant midi



À partir de midi



Avant midi



À partir de midi



À partir de midi



À partir de midi



Lire l'heure à la minute · Cahier 01

Lis l'heure à la minute. Chaque petite graduation vaut une minute. Tiens compte du moment indiqué et écris l'heure sur 24 heures.

Prénom: _____ Date: _____

Avant midi



Avant midi



Avant midi



Avant midi



À partir de midi



Avant midi



Lire l'heure à la minute · Cahier 01

Lis l'heure à la minute. Chaque petite graduation vaut une minute. Tiens compte du moment indiqué et écris l'heure sur 24 heures.

Prénom: _____ Date: _____

À partir de midi



À partir de midi



Avant midi



À partir de midi



À partir de midi



À partir de midi

