Reading time to the minute · Workbook 01

Read each clock to the nearest minute. Each small tick is one minute. Include a.m. or p.m.

Name: _____ Date: _____

p.m.



p.m.



p.m.



a.m.



a.m.



a.m.



Reading time to the minute · Workbook 01

Read each clock to the nearest minute. Each small tick is one minute. Include a.m. or p.m.

Name: _____ Date: _____

a.m.



p.m.



p.m.



p.m.



a.m.



p.m.



Reading time to the minute · Workbook 01

Read each clock to the nearest minute. Each small tick is one minute. Include a.m. or p.m.

Name: _____ Date: _____

a.m.



p.m.



a.m.



p.m.



p.m.



p.m.



Reading time to the minute · Workbook 01

Read each clock to the nearest minute. Each small tick is one minute. Include a.m. or p.m.

Name: _____ Date: _____

a.m.



a.m.



a.m.



a.m.



p.m.



a.m.



Reading time to the minute · Workbook 01

Read each clock to the nearest minute. Each small tick is one minute. Include a.m. or p.m.

Name: _____

Date: _____

p.m.



p.m.



a.m.



p.m.



p.m.



p.m.

