Minutengenaue Uhrzeiten · Übungsheft 01

Lies die Uhrzeit minutengenau ab. Jeder kleine Strich zählt eine Minute. Beachte die Tageshälfte und nutze das 24-Stunden-Format.

Name: _____ Datum: _____

Ab 12 Uhr



17:42 Uhr
5:42 p.m.

Ab 12 Uhr



18:36 Uhr
6:36 p.m.

Ab 12 Uhr



19:26 Uhr
7:26 p.m.

Vor 12 Uhr



06:11 Uhr
6:11 a.m.

Vor 12 Uhr



11:08 Uhr
11:08 a.m.

Vor 12 Uhr



10:29 Uhr
10:29 a.m.

Minutengenaue Uhrzeiten · Übungsheft 01

Lies die Uhrzeit minutengenau ab. Jeder kleine Strich zählt eine Minute. Beachte die Tageshälfte und nutze das 24-Stunden-Format.

Name: _____ Datum: _____

Vor 12 Uhr



06:57 Uhr
6:57 a.m.

Ab 12 Uhr



13:26 Uhr
1:26 p.m.

Ab 12 Uhr



19:07 Uhr
7:07 p.m.

Ab 12 Uhr



19:04 Uhr
7:04 p.m.

Vor 12 Uhr



09:31 Uhr
9:31 a.m.

Ab 12 Uhr



12:51 Uhr
12:51 p.m.

Minutengenaue Uhrzeiten · Übungsheft 01

Lies die Uhrzeit minutengenau ab. Jeder kleine Strich zählt eine Minute. Beachte die Tageshälfte und nutze das 24-Stunden-Format.

Name: _____ Datum: _____

Vor 12 Uhr



11:06 Uhr
11:06 a.m.

Ab 12 Uhr



15:19 Uhr
3:19 p.m.

Vor 12 Uhr



09:17 Uhr
9:17 a.m.

Ab 12 Uhr

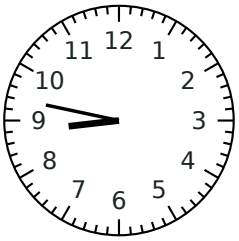

20:47 Uhr
8:47 p.m.

Ab 12 Uhr



16:09 Uhr
4:09 p.m.

Ab 12 Uhr



14:53 Uhr
2:53 p.m.

Minutengenaue Uhrzeiten · Übungsheft 01

Lies die Uhrzeit minutengenau ab. Jeder kleine Strich zählt eine Minute. Beachte die Tageshälfte und nutze das 24-Stunden-Format.

Name: _____ Datum: _____

Vor 12 Uhr



09:17 Uhr
9:17 a.m.

Vor 12 Uhr



06:17 Uhr
6:17 a.m.

Vor 12 Uhr



06:39 Uhr
6:39 a.m.

Vor 12 Uhr



08:08 Uhr
8:08 a.m.

Ab 12 Uhr



12:17 Uhr
12:17 p.m.

Vor 12 Uhr



10:18 Uhr
10:18 a.m.

Minutengenaue Uhrzeiten · Übungsheft 01

Lies die Uhrzeit minutengenau ab. Jeder kleine Strich zählt eine Minute. Beachte die Tageshälfte und nutze das 24-Stunden-Format.

Name: _____ Datum: _____

Ab 12 Uhr



12:38 Uhr
12:38 p.m.

Ab 12 Uhr



17:38 Uhr
5:38 p.m.

Vor 12 Uhr



09:51 Uhr
9:51 a.m.

Ab 12 Uhr



12:51 Uhr
12:51 p.m.

Ab 12 Uhr



18:16 Uhr
6:16 p.m.

Ab 12 Uhr



14:41 Uhr
2:41 p.m.