Minutengenaue Uhrzeiten · Übungsheft 01

Lies die Uhrzeit minutengenau ab. Jeder kleine Strich zählt eine Minute. Beachte die Tageshälfte und nutze das 24-Stunden-Format.

Name: _____ Datum: _____

Ab 12 Uhr



Ab 12 Uhr



Ab 12 Uhr



Vor 12 Uhr



Vor 12 Uhr



Vor 12 Uhr



Minutengenaue Uhrzeiten · Übungsheft 01

Lies die Uhrzeit minutengenau ab. Jeder kleine Strich zählt eine Minute. Beachte die Tageshälfte und nutze das 24-Stunden-Format.

Name: _____ Datum: _____

Vor 12 Uhr



Ab 12 Uhr



Ab 12 Uhr



Ab 12 Uhr



Vor 12 Uhr



Ab 12 Uhr



Minutengenaue Uhrzeiten · Übungsheft 01

Lies die Uhrzeit minutengenau ab. Jeder kleine Strich zählt eine Minute. Beachte die Tageshälfte und nutze das 24-Stunden-Format.

Name: _____ Datum: _____

Vor 12 Uhr



Ab 12 Uhr



Vor 12 Uhr



Ab 12 Uhr

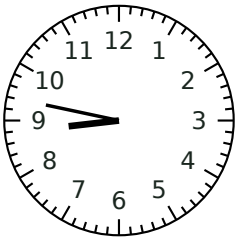

Ab 12 Uhr



Ab 12 Uhr



Minutengenaue Uhrzeiten · Übungsheft 01

Lies die Uhrzeit minutengenau ab. Jeder kleine Strich zählt eine Minute. Beachte die Tageshälfte und nutze das 24-Stunden-Format.

Name: _____ Datum: _____

Vor 12 Uhr



Vor 12 Uhr



Vor 12 Uhr



Vor 12 Uhr



Ab 12 Uhr



Vor 12 Uhr



Minutengenaue Uhrzeiten · Übungsheft 01

Lies die Uhrzeit minutengenau ab. Jeder kleine Strich zählt eine Minute. Beachte die Tageshälfte und nutze das 24-Stunden-Format.

Name: _____ Datum: _____

Ab 12 Uhr



Ab 12 Uhr



Vor 12 Uhr



Ab 12 Uhr



Ab 12 Uhr



Ab 12 Uhr

