Demi-heures et quarts d'heure · Cahier 01

Lis les demi-heures et les quarts d'heure : et quart (:15), et demie (:30), moins le quart (:45). Écris l'heure sur 24 heures.

Prénom: _____ Date: _____

Avant midi



Avant midi



À partir de midi



À partir de midi



À partir de midi



À partir de midi



Demi-heures et quarts d'heure · Cahier 01

Lis les demi-heures et les quarts d'heure : et quart (:15), et demie (:30), moins le quart (:45). Écris l'heure sur 24 heures.

Prénom: _____ Date: _____

Avant midi



À partir de midi



À partir de midi



À partir de midi



À partir de midi



Avant midi



Demi-heures et quarts d'heure · Cahier 01

Lis les demi-heures et les quarts d'heure : et quart (:15), et demie (:30), moins le quart (:45). Écris l'heure sur 24 heures.

Prénom: _____ Date: _____

À partir de midi



Avant midi



À partir de midi



À partir de midi



À partir de midi



À partir de midi



Demi-heures et quarts d'heure · Cahier 01

Lis les demi-heures et les quarts d'heure : et quart (:15), et demie (:30), moins le quart (:45). Écris l'heure sur 24 heures.

Prénom: _____ Date: _____

Avant midi



Avant midi



Avant midi



À partir de midi



À partir de midi



À partir de midi



Demi-heures et quarts d'heure · Cahier 01

Lis les demi-heures et les quarts d'heure : et quart (:15), et demie (:30), moins le quart (:45). Écris l'heure sur 24 heures.

Prénom: _____ Date: _____

À partir de midi



Avant midi



À partir de midi



Avant midi



Avant midi



À partir de midi

