Half-hours and quarter-hours · Workbook 01

Read each clock to the half-hour or quarter-hour. Quarter past is :15; half past is :30; quarter to is :45. Use a.m. or p.m.

Name: _____ Date: _____

a.m.



9:00 a.m.
09:00

a.m.



10:15 a.m.
10:15

p.m.



2:30 p.m.
14:30

p.m.



7:45 p.m.
19:45

p.m.



4:00 p.m.
16:00

p.m.



6:15 p.m.
18:15

Half-hours and quarter-hours · Workbook 01

Read each clock to the half-hour or quarter-hour. Quarter past is :15; half past is :30; quarter to is :45. Use a.m. or p.m.

Name: _____ Date: _____

a.m.



7:00 a.m.
07:00

p.m.



1:15 p.m.
13:15

p.m.



6:30 p.m.
18:30

p.m.



3:45 p.m.
15:45

p.m.



12:00 p.m.
12:00

a.m.



11:15 a.m.
11:15

Half-hours and quarter-hours · Workbook 01

Read each clock to the half-hour or quarter-hour. Quarter past is :15; half past is :30; quarter to is :45. Use a.m. or p.m.

Name: _____ Date: _____

p.m.



7:00 p.m.
19:00

a.m.



10:15 a.m.
10:15

p.m.



1:30 p.m.
13:30

p.m.



4:45 p.m.
16:45

p.m.



8:00 p.m.
20:00

p.m.



3:15 p.m.
15:15

Half-hours and quarter-hours · Workbook 01

Read each clock to the half-hour or quarter-hour. Quarter past is :15; half past is :30; quarter to is :45. Use a.m. or p.m.

Name: _____ Date: _____

a.m.



11:00 a.m.
11:00

a.m.



9:15 a.m.
09:15

a.m.



10:30 a.m.
10:30

p.m.



1:45 p.m.
13:45

p.m.



8:00 p.m.
20:00

p.m.



6:15 p.m.
18:15

Half-hours and quarter-hours · Workbook 01

Read each clock to the half-hour or quarter-hour. Quarter past is :15; half past is :30; quarter to is :45. Use a.m. or p.m.

Name: _____ Date: _____

p.m.



2:00 p.m.
14:00

a.m.



9:15 a.m.
09:15

p.m.



4:30 p.m.
16:30

a.m.



11:45 a.m.
11:45

a.m.



7:00 a.m.
07:00

p.m.



7:15 p.m.
19:15