Half-hours and quarter-hours · Workbook 01

Read each clock to the half-hour or quarter-hour. Quarter past is :15; half past is :30; quarter to is :45. Use a.m. or p.m.

Name: _____ Date: _____

a.m.



a.m.



p.m.



p.m.



p.m.



p.m.



Half-hours and quarter-hours · Workbook 01

Read each clock to the half-hour or quarter-hour. Quarter past is :15; half past is :30; quarter to is :45. Use a.m. or p.m.

Name: _____ Date: _____

a.m.



p.m.



p.m.



p.m.



p.m.



a.m.



Half-hours and quarter-hours · Workbook 01

Read each clock to the half-hour or quarter-hour. Quarter past is :15; half past is :30; quarter to is :45. Use a.m. or p.m.

Name: _____ Date: _____

p.m.



a.m.



p.m.



p.m.



p.m.



p.m.



Half-hours and quarter-hours · Workbook 01

Read each clock to the half-hour or quarter-hour. Quarter past is :15; half past is :30; quarter to is :45. Use a.m. or p.m.

Name: _____

Date: _____

a.m.



a.m.



a.m.



p.m.



p.m.



p.m.



Half-hours and quarter-hours · Workbook 01

Read each clock to the half-hour or quarter-hour. Quarter past is :15; half past is :30; quarter to is :45. Use a.m. or p.m.

Name: _____ Date: _____

p.m.



a.m.



p.m.



a.m.



a.m.



p.m.

