Hours and half-hours · Workbook 02

Read each clock to the hour or half-hour. The minute hand points to 12 or 6. Include a.m. or p.m. as shown.

Name: _____ Date: _____

a.m.



6:00 a.m.
06:00

p.m.



6:30 p.m.
18:30

p.m.



5:00 p.m.
17:00

a.m.



11:30 a.m.
11:30

p.m.



4:00 p.m.
16:00

p.m.



8:30 p.m.
20:30

Hours and half-hours · Workbook 02

Read each clock to the hour or half-hour. The minute hand points to 12 or 6. Include a.m. or p.m. as shown.

Name: _____ Date: _____

p.m.



3:00 p.m.
15:00

a.m.



6:30 a.m.
06:30

p.m.



12:00 p.m.
12:00

a.m.



7:30 a.m.
07:30

a.m.



9:00 a.m.
09:00

p.m.



6:30 p.m.
18:30

Hours and half-hours · Workbook 02

Read each clock to the hour or half-hour. The minute hand points to 12 or 6. Include a.m. or p.m. as shown.

Name: _____ Date: _____

p.m.



6:00 p.m.
18:00

a.m.



8:30 a.m.
08:30

a.m.



11:00 a.m.
11:00

p.m.



3:30 p.m.
15:30

p.m.



12:00 p.m.
12:00

a.m.



7:30 a.m.
07:30

Hours and half-hours · Workbook 02

Read each clock to the hour or half-hour. The minute hand points to 12 or 6. Include a.m. or p.m. as shown.

Name: _____ Date: _____

a.m.



8:00 a.m.
08:00

p.m.



6:30 p.m.
18:30

a.m.



10:00 a.m.
10:00

p.m.



2:30 p.m.
14:30

p.m.



1:00 p.m.
13:00

p.m.



12:30 p.m.
12:30

Hours and half-hours · Workbook 02

Read each clock to the hour or half-hour. The minute hand points to 12 or 6. Include a.m. or p.m. as shown.

Name: _____ Date: _____

p.m.



1:00 p.m.
13:00

a.m.



10:30 a.m.
10:30

p.m.



4:00 p.m.
16:00

a.m.



9:30 a.m.
09:30

a.m.



7:00 a.m.
07:00

p.m.



8:30 p.m.
20:30