Hours and half-hours · Workbook 02

Read each clock to the hour or half-hour. The minute hand points to 12 or 6. Include a.m. or p.m. as shown.

Name: _____ Date: _____

a.m.



p.m.



p.m.



a.m.



p.m.



p.m.



Hours and half-hours · Workbook 02

Read each clock to the hour or half-hour. The minute hand points to 12 or 6. Include a.m. or p.m. as shown.

Name: _____ Date: _____

p.m.



a.m.



p.m.



a.m.



a.m.



p.m.



Hours and half-hours · Workbook 02

Read each clock to the hour or half-hour. The minute hand points to 12 or 6. Include a.m. or p.m. as shown.

Name: _____ Date: _____

p.m.



a.m.



a.m.



p.m.



p.m.



a.m.



Hours and half-hours · Workbook 02

Read each clock to the hour or half-hour. The minute hand points to 12 or 6. Include a.m. or p.m. as shown.

Name: _____ Date: _____

a.m.



p.m.



a.m.



p.m.



p.m.



p.m.



Hours and half-hours · Workbook 02

Read each clock to the hour or half-hour. The minute hand points to 12 or 6. Include a.m. or p.m. as shown.

Name: _____ Date: _____

p.m.



a.m.



p.m.



a.m.



a.m.



p.m.

