L'heure de cinq en cinq · Cahier 02

Lis l'heure de cinq en cinq minutes. La petite aiguille avance entre deux nombres. Écris l'heure sur 24 heures.

Prénom: _____ Date: _____

Avant midi



09 h 30
9:30 a.m.

À partir de midi



19 h 45
7:45 p.m.

À partir de midi



13 h 25
1:25 p.m.

À partir de midi



17 h 20
5:20 p.m.

À partir de midi



16 h 20
4:20 p.m.

À partir de midi



13 h 40
1:40 p.m.

L'heure de cinq en cinq · Cahier 02

Lis l'heure de cinq en cinq minutes. La petite aiguille avance entre deux nombres. Écris l'heure sur 24 heures.

Prénom: _____ Date: _____

Avant midi



08 h 10
8:10 a.m.

À partir de midi



19 h 40
7:40 p.m.

À partir de midi



12 h 10
12:10 p.m.

À partir de midi



16 h 30
4:30 p.m.

À partir de midi



16 h 20
4:20 p.m.

À partir de midi



19 h 10
7:10 p.m.

L'heure de cinq en cinq · Cahier 02

Lis l'heure de cinq en cinq minutes. La petite aiguille avance entre deux nombres. Écris l'heure sur 24 heures.

Prénom: _____ Date: _____

À partir de midi



16 h 40
4:40 p.m.

Avant midi



10 h 20
10:20 a.m.

Avant midi



07 h 45
7:45 a.m.

À partir de midi



20 h 05
8:05 p.m.

Avant midi



09 h 55
9:55 a.m.

À partir de midi



19 h 35
7:35 p.m.

L'heure de cinq en cinq · Cahier 02

Lis l'heure de cinq en cinq minutes. La petite aiguille avance entre deux nombres. Écris l'heure sur 24 heures.

Prénom: _____ Date: _____

À partir de midi



13 h 40
1:40 p.m.

À partir de midi



16 h 35
4:35 p.m.

Avant midi



08 h 45
8:45 a.m.

Avant midi



10 h 50
10:50 a.m.

À partir de midi



14 h 25
2:25 p.m.

Avant midi



07 h 35
7:35 a.m.

L'heure de cinq en cinq · Cahier 02

Lis l'heure de cinq en cinq minutes. La petite aiguille avance entre deux nombres. Écris l'heure sur 24 heures.

Prénom: _____ Date: _____

À partir de midi



14 h 40
2:40 p.m.

Avant midi



10 h 55
10:55 a.m.

Avant midi



06 h 30
6:30 a.m.

Avant midi



07 h 05
7:05 a.m.

À partir de midi



12 h 45
12:45 p.m.

Avant midi



06 h 15
6:15 a.m.