L'heure de cinq en cinq · Cahier 02

Lis l'heure de cinq en cinq minutes. La petite aiguille avance entre deux nombres. Écris l'heure sur 24 heures.

Prénom: _____ Date: _____

Avant midi



À partir de midi



À partir de midi



À partir de midi



À partir de midi



À partir de midi



L'heure de cinq en cinq · Cahier 02

Lis l'heure de cinq en cinq minutes. La petite aiguille avance entre deux nombres. Écris l'heure sur 24 heures.

Prénom: _____ Date: _____

Avant midi



À partir de midi



À partir de midi



À partir de midi



À partir de midi



À partir de midi



L'heure de cinq en cinq · Cahier 02

Lis l'heure de cinq en cinq minutes. La petite aiguille avance entre deux nombres. Écris l'heure sur 24 heures.

Prénom: _____ Date: _____

À partir de midi



Avant midi



Avant midi



À partir de midi



Avant midi



À partir de midi



L'heure de cinq en cinq · Cahier 02

Lis l'heure de cinq en cinq minutes. La petite aiguille avance entre deux nombres. Écris l'heure sur 24 heures.

Prénom: _____ Date: _____

À partir de midi



À partir de midi



Avant midi



Avant midi



À partir de midi



Avant midi



L'heure de cinq en cinq · Cahier 02

Lis l'heure de cinq en cinq minutes. La petite aiguille avance entre deux nombres. Écris l'heure sur 24 heures.

Prénom: _____ Date: _____

À partir de midi



Avant midi



Avant midi



Avant midi



À partir de midi



Avant midi

