Find the start time · Workbook 04

The clock shows the finish time. Subtract the shown minutes to find the start time. Include a.m. or p.m. All times are on the same day.

Name: _____ Date: _____

a.m.



- 16 min

6:04 a.m.
06:04

a.m.



- 73 min

10:15 a.m.
10:15

a.m.



- 102 min

6:33 a.m.
06:33

p.m.



- 1 min

12:07 p.m.
12:07

p.m.



- 91 min

12:55 p.m.
12:55

p.m.



- 18 min

7:48 p.m.
19:48

Find the start time · Workbook 04

The clock shows the finish time. Subtract the shown minutes to find the start time. Include a.m. or p.m. All times are on the same day.

Name: _____ Date: _____

p.m.



- 22 min

2:01 p.m.
14:01

a.m.



- 111 min

6:32 a.m.
06:32

p.m.



- 29 min

12:23 p.m.
12:23

p.m.



- 99 min

1:02 p.m.
13:02

p.m.



- 73 min

6:49 p.m.
18:49

p.m.



- 38 min

2:33 p.m.
14:33

Find the start time · Workbook 04

The clock shows the finish time. Subtract the shown minutes to find the start time. Include a.m. or p.m. All times are on the same day.

Name: _____ Date: _____

p.m.



- 115 min

11:29 a.m.
11:29

p.m.



- 2 min

1:23 p.m.
13:23

p.m.



- 79 min

5:38 p.m.
17:38

p.m.



- 95 min

5:39 p.m.
17:39

a.m.



- 26 min

8:27 a.m.
08:27

a.m.



- 71 min

6:52 a.m.
06:52

Find the start time · Workbook 04

The clock shows the finish time. Subtract the shown minutes to find the start time. Include a.m. or p.m. All times are on the same day.

Name: _____ Date: _____

p.m.



- 106 min

6:25 p.m.
18:25

p.m.



- 60 min

4:21 p.m.
16:21

p.m.



- 52 min

12:24 p.m.
12:24

a.m.



- 48 min

10:10 a.m.
10:10

a.m.



- 107 min

6:22 a.m.
06:22

a.m.



- 60 min

6:29 a.m.
06:29

Find the start time · Workbook 04

The clock shows the finish time. Subtract the shown minutes to find the start time. Include a.m. or p.m. All times are on the same day.

Name: _____ Date: _____

p.m.



- 15 min

3:37 p.m.
15:37

a.m.



- 39 min

6:59 a.m.
06:59

p.m.



- 70 min

11:26 a.m.
11:26

p.m.



- 6 min

6:14 p.m.
18:14

p.m.



- 29 min

7:10 p.m.
19:10

a.m.



- 50 min

10:04 a.m.
10:04