Find the start time · Workbook 04

The clock shows the finish time. Subtract the shown minutes to find the start time. Include a.m. or p.m. All times are on the same day.

Name: _____ Date: _____

a.m.



- 16 min

a.m.



- 73 min

a.m.



- 102 min

p.m.



- 1 min

p.m.



- 91 min

p.m.



- 18 min

Find the start time · Workbook 04

The clock shows the finish time. Subtract the shown minutes to find the start time. Include a.m. or p.m. All times are on the same day.

Name: _____ Date: _____

p.m.



- 22 min

a.m.



- 111 min

p.m.



- 29 min

p.m.



- 99 min

p.m.



- 73 min

p.m.



- 38 min

Find the start time · Workbook 04

The clock shows the finish time. Subtract the shown minutes to find the start time. Include a.m. or p.m. All times are on the same day.

Name: _____ Date: _____

p.m.



- 115 min

p.m.



- 2 min

p.m.



- 79 min

p.m.



- 95 min

a.m.



- 26 min

a.m.



- 71 min

Find the start time · Workbook 04

The clock shows the finish time. Subtract the shown minutes to find the start time. Include a.m. or p.m. All times are on the same day.

Name: _____ Date: _____

p.m.



- 106 min

p.m.



- 60 min

p.m.



- 52 min

a.m.



- 48 min

a.m.



- 107 min

a.m.



- 60 min

Find the start time · Workbook 04

The clock shows the finish time. Subtract the shown minutes to find the start time. Include a.m. or p.m. All times are on the same day.

Name: _____ Date: _____

p.m.



- 15 min

a.m.



- 39 min

p.m.



- 70 min

p.m.



- 6 min

p.m.



- 29 min

a.m.



- 50 min