# Finde die Startzeit · Übungsheft 04

Die Uhr zeigt die Endzeit. Ziehe die angegebenen Minuten ab, um die Startzeit zu finden. Nutze das 24-Stunden-Format. Alle Zeiten liegen am selben Tag.

Name: _____ Datum: _____

Vor 12 Uhr



- 16 min

06:04 Uhr
6:04 a.m.

Vor 12 Uhr



- 73 min

10:15 Uhr
10:15 a.m.

Vor 12 Uhr



- 102 min

06:33 Uhr
6:33 a.m.

Ab 12 Uhr



- 1 min

12:07 Uhr
12:07 p.m.

Ab 12 Uhr



- 91 min

12:55 Uhr
12:55 p.m.

Ab 12 Uhr



- 18 min

19:48 Uhr
7:48 p.m.

# Finde die Startzeit · Übungsheft 04

Die Uhr zeigt die Endzeit. Ziehe die angegebenen Minuten ab, um die Startzeit zu finden. Nutze das 24-Stunden-Format. Alle Zeiten liegen am selben Tag.

Name: _____ Datum: _____

Ab 12 Uhr




- 22 min

14:01 Uhr
2:01 p.m.

Vor 12 Uhr




- 111 min

06:32 Uhr
6:32 a.m.

Ab 12 Uhr




- 29 min

12:23 Uhr
12:23 p.m.

Ab 12 Uhr




- 99 min

13:02 Uhr
1:02 p.m.

Ab 12 Uhr




- 73 min

18:49 Uhr
6:49 p.m.

Ab 12 Uhr




- 38 min

14:33 Uhr
2:33 p.m.

# Finde die Startzeit · Übungsheft 04

Die Uhr zeigt die Endzeit. Ziehe die angegebenen Minuten ab, um die Startzeit zu finden. Nutze das 24-Stunden-Format. Alle Zeiten liegen am selben Tag.

Name: _____ Datum: _____

Ab 12 Uhr



- 115 min

11:29 Uhr
11:29 a.m.

Ab 12 Uhr



- 2 min

13:23 Uhr
1:23 p.m.

Ab 12 Uhr



- 79 min

17:38 Uhr
5:38 p.m.

Ab 12 Uhr



- 95 min

17:39 Uhr
5:39 p.m.

Vor 12 Uhr



- 26 min

08:27 Uhr
8:27 a.m.

Vor 12 Uhr



- 71 min

06:52 Uhr
6:52 a.m.

# Finde die Startzeit · Übungsheft 04

Die Uhr zeigt die Endzeit. Ziehe die angegebenen Minuten ab, um die Startzeit zu finden. Nutze das 24-Stunden-Format. Alle Zeiten liegen am selben Tag.

Name: _____ Datum: _____

Ab 12 Uhr



- 106 min

18:25 Uhr
6:25 p.m.

Ab 12 Uhr



- 60 min

16:21 Uhr
4:21 p.m.

Ab 12 Uhr



- 52 min

12:24 Uhr
12:24 p.m.

Vor 12 Uhr



- 48 min

10:10 Uhr
10:10 a.m.

Vor 12 Uhr



- 107 min

06:22 Uhr
6:22 a.m.

Vor 12 Uhr



- 60 min

06:29 Uhr
6:29 a.m.

# Finde die Startzeit · Übungsheft 04

Die Uhr zeigt die Endzeit. Ziehe die angegebenen Minuten ab, um die Startzeit zu finden. Nutze das 24-Stunden-Format. Alle Zeiten liegen am selben Tag.

Name: _____ Datum: _____

Ab 12 Uhr




- 15 min

15:37 Uhr
3:37 p.m.

Vor 12 Uhr




- 39 min

06:59 Uhr
6:59 a.m.

Ab 12 Uhr




- 70 min

11:26 Uhr
11:26 a.m.

Ab 12 Uhr




- 6 min

18:14 Uhr
6:14 p.m.

Ab 12 Uhr




- 29 min

19:10 Uhr
7:10 p.m.

Vor 12 Uhr




- 50 min

10:04 Uhr
10:04 a.m.