Finde die Startzeit · Übungsheft 04

Die Uhr zeigt die Endzeit. Ziehe die angegebenen Minuten ab, um die Startzeit zu finden. Nutze das 24-Stunden-Format. Alle Zeiten liegen am selben Tag.

Name: _____ Datum: _____

Vor 12 Uhr



- 16 min

Vor 12 Uhr



- 73 min

Vor 12 Uhr



- 102 min

Ab 12 Uhr



- 1 min

Ab 12 Uhr



- 91 min

Ab 12 Uhr



- 18 min

Finde die Startzeit · Übungsheft 04

Die Uhr zeigt die Endzeit. Ziehe die angegebenen Minuten ab, um die Startzeit zu finden. Nutze das 24-Stunden-Format. Alle Zeiten liegen am selben Tag.

Name: _____ Datum: _____

Ab 12 Uhr



- 22 min

Vor 12 Uhr



- 111 min

Ab 12 Uhr



- 29 min

Ab 12 Uhr



- 99 min

Ab 12 Uhr



- 73 min

Ab 12 Uhr



- 38 min

Finde die Startzeit · Übungsheft 04

Die Uhr zeigt die Endzeit. Ziehe die angegebenen Minuten ab, um die Startzeit zu finden. Nutze das 24-Stunden-Format. Alle Zeiten liegen am selben Tag.

Name: _____ Datum: _____

Ab 12 Uhr



- 115 min

Ab 12 Uhr



- 2 min

Ab 12 Uhr



- 79 min

Ab 12 Uhr



- 95 min

Vor 12 Uhr



- 26 min

Vor 12 Uhr



- 71 min

Finde die Startzeit · Übungsheft 04

Die Uhr zeigt die Endzeit. Ziehe die angegebenen Minuten ab, um die Startzeit zu finden. Nutze das 24-Stunden-Format. Alle Zeiten liegen am selben Tag.

Name: _____ Datum: _____

Ab 12 Uhr



- 106 min

Ab 12 Uhr



- 60 min

Ab 12 Uhr



- 52 min

Vor 12 Uhr



- 48 min

Vor 12 Uhr



- 107 min

Vor 12 Uhr



- 60 min

Finde die Startzeit · Übungsheft 04

Die Uhr zeigt die Endzeit. Ziehe die angegebenen Minuten ab, um die Startzeit zu finden. Nutze das 24-Stunden-Format. Alle Zeiten liegen am selben Tag.

Name: _____ Datum: _____

Ab 12 Uhr



- 15 min

Vor 12 Uhr



- 39 min

Ab 12 Uhr



- 70 min

Ab 12 Uhr



- 6 min

Ab 12 Uhr



- 29 min

Vor 12 Uhr



- 50 min