Add minutes to the time · Workbook 03

Read the start time to the minute. Add the shown minutes and write the finish time with a.m. or p.m. Check the hour change.

Name: _____ Date: _____

p.m.



+ 24 min

4:48 p.m.
16:48

a.m.



+ 57 min

11:18 a.m.
11:18

a.m.



+ 12 min

10:48 a.m.
10:48

p.m.



+ 4 min

7:00 p.m.
19:00

p.m.



+ 37 min

2:59 p.m.
14:59

p.m.



+ 57 min

1:18 p.m.
13:18

Add minutes to the time · Workbook 03

Read the start time to the minute. Add the shown minutes and write the finish time with a.m. or p.m. Check the hour change.

Name: _____ Date: _____

p.m.



+ 47 min

1:08 p.m.
13:08

p.m.



+ 4 min

3:55 p.m.
15:55

p.m.



+ 16 min

2:50 p.m.
14:50

p.m.



+ 49 min

8:15 p.m.
20:15

a.m.



+ 51 min

7:49 a.m.
07:49

a.m.



+ 8 min

7:34 a.m.
07:34

Add minutes to the time · Workbook 03

Read the start time to the minute. Add the shown minutes and write the finish time with a.m. or p.m. Check the hour change.

Name: _____ Date: _____

p.m.



+ 3 min

6:46 p.m.
18:46

a.m.



+ 29 min

6:43 a.m.
06:43

p.m.



+ 7 min

5:46 p.m.
17:46

p.m.



+ 33 min

8:17 p.m.
20:17

p.m.



+ 23 min

8:11 p.m.
20:11

p.m.



+ 39 min

5:55 p.m.
17:55

Add minutes to the time · Workbook 03

Read the start time to the minute. Add the shown minutes and write the finish time with a.m. or p.m. Check the hour change.

Name: _____ Date: _____

p.m.



+ 46 min

7:12 p.m.
19:12

p.m.



+ 26 min

6:24 p.m.
18:24

a.m.



+ 53 min

8:36 a.m.
08:36

p.m.



+ 47 min

8:46 p.m.
20:46

a.m.



+ 51 min

11:02 a.m.
11:02

a.m.



+ 9 min

7:41 a.m.
07:41

Add minutes to the time · Workbook 03

Read the start time to the minute. Add the shown minutes and write the finish time with a.m. or p.m. Check the hour change.

Name: _____ Date: _____

p.m.



+ 38 min

8:39 p.m.
20:39

a.m.



+ 33 min

7:29 a.m.
07:29

a.m.



+ 7 min

9:25 a.m.
09:25

a.m.



+ 9 min

9:32 a.m.
09:32

a.m.



+ 16 min

9:43 a.m.
09:43

a.m.



+ 21 min

9:47 a.m.
09:47