Add minutes to the time · Workbook 03

Read the start time to the minute. Add the shown minutes and write the finish time with a.m. or p.m. Check the hour change.

Name: _____ Date: _____

p.m.



+ 24 min

a.m.



+ 57 min

a.m.



+ 12 min

p.m.



+ 4 min

p.m.



+ 37 min

p.m.



+ 57 min

Add minutes to the time · Workbook 03

Read the start time to the minute. Add the shown minutes and write the finish time with a.m. or p.m. Check the hour change.

Name: _____ Date: _____

p.m.



+ 47 min

p.m.



+ 4 min

p.m.



+ 16 min

p.m.



+ 49 min

a.m.



+ 51 min

a.m.



+ 8 min

Add minutes to the time · Workbook 03

Read the start time to the minute. Add the shown minutes and write the finish time with a.m. or p.m. Check the hour change.

Name: _____ Date: _____

p.m.



+ 3 min

a.m.



+ 29 min

p.m.



+ 7 min

p.m.



+ 33 min

p.m.

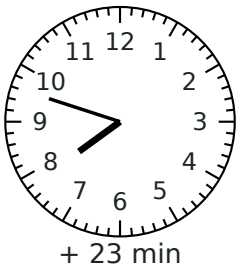

+ 23 min

p.m.



+ 39 min

Add minutes to the time · Workbook 03

Read the start time to the minute. Add the shown minutes and write the finish time with a.m. or p.m. Check the hour change.

Name: _____ Date: _____

p.m.



+ 46 min

p.m.



+ 26 min

a.m.



+ 53 min

p.m.



+ 47 min

a.m.



+ 51 min

a.m.



+ 9 min

Add minutes to the time · Workbook 03

Read the start time to the minute. Add the shown minutes and write the finish time with a.m. or p.m. Check the hour change.

Name: _____ Date: _____

p.m.



+ 38 min

a.m.



+ 33 min

a.m.



+ 7 min

a.m.



+ 9 min

a.m.



+ 16 min

a.m.



+ 21 min