Minuten zur Uhrzeit addieren · Übungsheft 03

Lies die Startzeit minutengenau ab. Addiere die angegebene Zeitspanne und schreibe die Endzeit im 24-Stunden-Format auf. Achte auf den Stundenwechsel.

Name: _____ Datum: _____

Ab 12 Uhr



+ 24 min

16:48 Uhr
4:48 p.m.

Vor 12 Uhr



+ 57 min

11:18 Uhr
11:18 a.m.

Vor 12 Uhr



+ 12 min

10:48 Uhr
10:48 a.m.

Ab 12 Uhr



+ 4 min

19:00 Uhr
7:00 p.m.

Ab 12 Uhr



+ 37 min

14:59 Uhr
2:59 p.m.

Ab 12 Uhr



+ 57 min

13:18 Uhr
1:18 p.m.

Minuten zur Uhrzeit addieren · Übungsheft 03

Lies die Startzeit minutengenau ab. Addiere die angegebene Zeitspanne und schreibe die Endzeit im 24-Stunden-Format auf. Achte auf den Stundenwechsel.

Name: _____ Datum: _____

Ab 12 Uhr



+ 47 min

13:08 Uhr
1:08 p.m.

Ab 12 Uhr



+ 4 min

15:55 Uhr
3:55 p.m.

Ab 12 Uhr



+ 16 min

14:50 Uhr
2:50 p.m.

Ab 12 Uhr



+ 49 min

20:15 Uhr
8:15 p.m.

Vor 12 Uhr



+ 51 min

07:49 Uhr
7:49 a.m.

Vor 12 Uhr



+ 8 min

07:34 Uhr
7:34 a.m.

Minuten zur Uhrzeit addieren · Übungsheft 03

Lies die Startzeit minutengenau ab. Addiere die angegebene Zeitspanne und schreibe die Endzeit im 24-Stunden-Format auf. Achte auf den Stundenwechsel.

Name: _____ Datum: _____

Ab 12 Uhr



+ 3 min

18:46 Uhr
6:46 p.m.

Vor 12 Uhr



+ 29 min

06:43 Uhr
6:43 a.m.

Ab 12 Uhr



+ 7 min

17:46 Uhr
5:46 p.m.

Ab 12 Uhr



+ 33 min

20:17 Uhr
8:17 p.m.

Ab 12 Uhr



+ 23 min

20:11 Uhr
8:11 p.m.

Ab 12 Uhr



+ 39 min

17:55 Uhr
5:55 p.m.

Minuten zur Uhrzeit addieren · Übungsheft 03

Lies die Startzeit minutengenau ab. Addiere die angegebene Zeitspanne und schreibe die Endzeit im 24-Stunden-Format auf. Achte auf den Stundenwechsel.

Name: _____ Datum: _____

Ab 12 Uhr



+ 46 min

19:12 Uhr
7:12 p.m.

Ab 12 Uhr



+ 26 min

18:24 Uhr
6:24 p.m.

Vor 12 Uhr



+ 53 min

08:36 Uhr
8:36 a.m.

Ab 12 Uhr



+ 47 min

20:46 Uhr
8:46 p.m.

Vor 12 Uhr



+ 51 min

11:02 Uhr
11:02 a.m.

Vor 12 Uhr



+ 9 min

07:41 Uhr
7:41 a.m.

Minuten zur Uhrzeit addieren · Übungsheft 03

Lies die Startzeit minutengenau ab. Addiere die angegebene Zeitspanne und schreibe die Endzeit im 24-Stunden-Format auf. Achte auf den Stundenwechsel.

Name: _____ Datum: _____

Ab 12 Uhr



+ 38 min

20:39 Uhr
8:39 p.m.

Vor 12 Uhr



+ 33 min

07:29 Uhr
7:29 a.m.

Vor 12 Uhr



+ 7 min

09:25 Uhr
9:25 a.m.

Vor 12 Uhr



+ 9 min

09:32 Uhr
9:32 a.m.

Vor 12 Uhr



+ 16 min

09:43 Uhr
9:43 a.m.

Vor 12 Uhr



+ 21 min

09:47 Uhr
9:47 a.m.