Find the finish time · Workbook 02

Read the start time, then add the shown minutes. Write the finish time with a.m. or p.m. Check whether the hour changes.

Name: _____ Date: _____

p.m.



+ 35 min

6:20 p.m.
18:20

p.m.



+ 15 min

5:45 p.m.
17:45

p.m.



+ 45 min

1:15 p.m.
13:15

a.m.



+ 55 min

10:45 a.m.
10:45

p.m.



+ 45 min

5:25 p.m.
17:25

p.m.



+ 30 min

5:15 p.m.
17:15

Find the finish time · Workbook 02

Read the start time, then add the shown minutes. Write the finish time with a.m. or p.m. Check whether the hour changes.

Name: _____ Date: _____

a.m.



+ 40 min

10:30 a.m.
10:30

p.m.



+ 25 min

1:05 p.m.
13:05

p.m.



+ 15 min

3:05 p.m.
15:05

a.m.



+ 50 min

6:55 a.m.
06:55

p.m.



+ 50 min

6:05 p.m.
18:05

a.m.



+ 30 min

12:10 p.m.
12:10

Find the finish time · Workbook 02

Read the start time, then add the shown minutes. Write the finish time with a.m. or p.m. Check whether the hour changes.

Name: _____ Date: _____

p.m.



+ 45 min

12:45 p.m.
12:45

p.m.



+ 20 min

9:00 p.m.
21:00

p.m.



+ 40 min

8:35 p.m.
20:35

p.m.



+ 25 min

6:20 p.m.
18:20

p.m.



+ 30 min

4:35 p.m.
16:35

p.m.



+ 45 min

5:30 p.m.
17:30

Find the finish time · Workbook 02

Read the start time, then add the shown minutes. Write the finish time with a.m. or p.m. Check whether the hour changes.

Name: _____ Date: _____

p.m.



+ 45 min

1:35 p.m.
13:35

p.m.



+ 20 min

1:20 p.m.
13:20

a.m.



+ 35 min

6:55 a.m.
06:55

p.m.



+ 50 min

5:40 p.m.
17:40

a.m.



+ 35 min

9:10 a.m.
09:10

a.m.



+ 35 min

11:45 a.m.
11:45

Find the finish time · Workbook 02

Read the start time, then add the shown minutes. Write the finish time with a.m. or p.m. Check whether the hour changes.

Name: _____ Date: _____

p.m.



+ 25 min

2:25 p.m.
14:25

p.m.



+ 40 min

2:55 p.m.
14:55

p.m.



+ 50 min

2:30 p.m.
14:30

p.m.



+ 45 min

4:00 p.m.
16:00

a.m.



+ 25 min

8:25 a.m.
08:25

p.m.



+ 25 min

3:45 p.m.
15:45