Find the finish time · Workbook 02

Read the start time, then add the shown minutes. Write the finish time with a.m. or p.m. Check whether the hour changes.

Name: _____ Date: _____

p.m.



+ 35 min

p.m.



+ 15 min

p.m.



+ 45 min

a.m.



+ 55 min

p.m.



+ 45 min

p.m.



+ 30 min

Find the finish time · Workbook 02

Read the start time, then add the shown minutes. Write the finish time with a.m. or p.m. Check whether the hour changes.

Name: _____ Date: _____

a.m.



+ 40 min

p.m.



+ 25 min

p.m.



+ 15 min

a.m.



+ 50 min

p.m.



+ 50 min

a.m.



+ 30 min

Find the finish time · Workbook 02

Read the start time, then add the shown minutes. Write the finish time with a.m. or p.m. Check whether the hour changes.

Name: _____ Date: _____

p.m.



+ 45 min

p.m.



+ 20 min

p.m.



+ 40 min

p.m.



+ 25 min

p.m.



+ 30 min

p.m.



+ 45 min

Find the finish time · Workbook 02

Read the start time, then add the shown minutes. Write the finish time with a.m. or p.m. Check whether the hour changes.

Name: _____ Date: _____

p.m.



+ 45 min

p.m.



+ 20 min

a.m.



+ 35 min

p.m.



+ 50 min

a.m.



+ 35 min

a.m.



+ 35 min

Find the finish time · Workbook 02

Read the start time, then add the shown minutes. Write the finish time with a.m. or p.m. Check whether the hour changes.

Name: _____ Date: _____

p.m.



+ 25 min

p.m.



+ 40 min

p.m.



+ 50 min

p.m.



+ 45 min

a.m.



+ 25 min

p.m.



+ 25 min