Find Four Arrows · Grade 3 · Workbook 02

Draw a box around every 2 × 2 square with four different arrows: up, right, down and left. Squares can share cells.

Name: _____

Date: _____

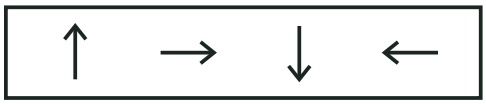



Find Four Arrows · Grade 3 · Workbook 02

Draw a box around every 2 × 2 square with four different arrows: up, right, down and left. Squares can share cells.

Name: _____

Date: _____

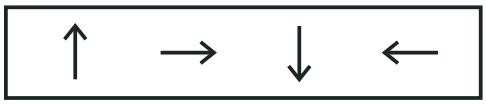



Find Four Arrows · Grade 3 · Workbook 02

Draw a box around every 2 × 2 square with four different arrows: up, right, down and left. Squares can share cells.

Name: _____

Date: _____

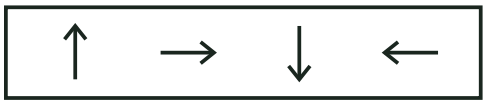



Find Four Arrows · Grade 3 · Workbook 02

Draw a box around every 2 × 2 square with four different arrows: up, right, down and left. Squares can share cells.

Name: _____

Date: _____

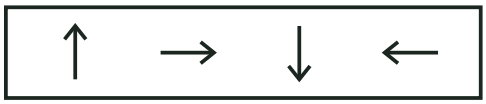



Find Four Arrows · Grade 3 · Workbook 02

Draw a box around every 2 × 2 square with four different arrows: up, right, down and left. Squares can share cells.

Name: _____

Date: _____

